GOVT. OF NCT OF DELHI

Delhi Subordinate Services Selection Board

FC-18, Institutional Area, Karkardooma, Delhi – 110092.

www.dsssb.delhigovt.nic.in

Test Date	30/09/2026
Test Time	5:00 PM - 7:00 PM
Subject	Assistant Section Officer

Section : **General Awareness**

Q.1 The Tribunals Reforms Bill, 2026, passed by Parliament, proposes to establish which of the following institutions to strengthen the independence, transparency, and efficiency of tribunals?

Ans
- ✗ 1. National Tribunal Reforms Commission
- ✗ 2. National Judicial Appointments Commission
- ✗ 3. National Tribunals Legal Services Commission
- ✓ 4. National Tribunals Commission

Q.2 The Industrial Policy Resolution of 1956 provided the institutional framework for which Five-Year Plan, heavily influenced by the Mahalanobis strategy emphasizing heavy industries?

Ans
- ✗ 1. Eighth Five-Year Plan
- ✓ 2. Second Five-Year Plan
- ✗ 3. First Five-Year Plan
- ✗ 4. Fourth Five-Year Plan

Q.3 In June 2026, the Bureau of Indian Standards (BIS) released the Indian Standard IS 20201:2026. Which of the following domains does this standard cover?

Ans
- ✓ 1. Community Seed Bank Management
- ✗ 2. Organic Fertiliser Certification
- ✗ 3. Commercial Drone Airworthiness
- ✗ 4. Solar Cell Inverters and Grid Storage

Q.4 To reduce transfer-pricing disputes and enhance tax certainty for the IT services sector, the Union Budget 2026–27 raised the transaction-value threshold for availing Safe Harbour provisions from ₹300 crore to what amount?

Ans
- ✗ 1. ₹1,000 crore
- ✓ 2. ₹2,000 crore
- ✗ 3. ₹2,500 crore
- ✗ 4. ₹1,500 crore

Q.5 Which major international summit was hosted in Dubai in February 2026?

Ans
- ✗ 1. World Economic Forum
- ✓ 2. World Governments Summit
- ✗ 3. WTO Ministerial Conference
- ✗ 4. Munich Security Conference

Generated by rank.qmaths.in

Q.6 **Vempati Chinna Satyam is most renowned for his contributions to which aspect of Indian classical dance?**

Ans
- ✗ 1. Choreographing Kathak ballets
- ✓ 2. Revitalizing Kuchipudi classical dance
- ✗ 3. Documenting Manipuri folk dances
- ✗ 4. Researching Mohiniyattam traditions

Q.7 **In India's infrastructure development strategy, which investment addresses both urban congestion and environmental sustainability by promoting mass transit solutions?**

Ans
- ✗ 1. Establishment of logistics parks
- ✓ 2. Expansion of urban rapid transit systems
- ✗ 3. Upgradation of rural banking infrastructure
- ✗ 4. Construction of expressways

Q.8 **Which monetary policy instrument is currently used by the Reserve Bank of India as its key policy rate for regulating short-term liquidity?**

Ans
- ✗ 1. Open market stock purchases
- ✗ 2. Bank mergers in public sector
- ✗ 3. Fiscal deficit reduction measures
- ✓ 4. Repo rate adjustments by RBI

Q.9 **Which literary figure is associated with the Sanskrit poetic work 'Saundarananda'?**

Ans
- ✗ 1. Varahamihira
- ✗ 2. Charak
- ✓ 3. Ashvaghosha
- ✗ 4. Sushruta

Q.10 **Which of the following correctly identifies the two elements that are liquid at room temperature?**

Ans
- ✗ 1. Copper and Chlorine
- ✗ 2. Lead and Nitrogen
- ✓ 3. Mercury and Bromine
- ✗ 4. Gallium and Cesium

Q.11 **Who wrote the internationally discussed book *Empire of AI: Dreams and Nightmares in Sam Altman's OpenAI*, published in 2026?**

Ans
- ✓ 1. Karen Hao
- ✗ 2. Kai-Fu Lee
- ✗ 3. Fei-Fei Li
- ✗ 4. Mustafa Suleyman

Q.12 **Which description corresponds to Thomson's atomic model?**

Ans
- ✗ 1. Electrons occupy fixed shells around a dense nucleus
- ✗ 2. Electrons orbit a nucleus containing only neutrons
- ✓ 3. Electrons are embedded in a positively charged sphere
- ✗ 4. The atom is an indivisible sphere without charged particles

Q.13 **According to the Economic Survey 2025-2026, the agriculture and allied sector in India is estimated to grow at what rate in FY26?**

Ans
- ✗ 1. 5.6%
- ✗ 2. 3.6%
- ✓ 3. 3.1%
- ✗ 4. 2.9%

Black book

Q.14 **Which type of mirror is most suitable for concentrating sunlight to achieve high temperatures in a solar furnace?**

Ans
- ✗ 1. Convex mirror
- ✗ 2. Plane mirror
- ✗ 3. Cylindrical mirror
- ✓ 4. Concave mirror

Q.15 **Which classical dance form originated from Kerala and is known for its balanced, slow pace and gentle, graceful movement patterns?**

Ans
- ✗ 1. Kathakali
- ✗ 2. Kuchipudi
- ✗ 3. Manipuri
- ✓ 4. Mohiniyattam

Q.16 **Which protected wetland was designated as India's 100th Ramsar Site on World Environment Day (5 June 2026)?**

Ans
- ✗ 1. Nanjarayan Bird Sanctuary
- ✗ 2. Kopra Jalasay
- ✗ 3. Shekha Jheel Bird Sanctuary
- ✓ 4. Jai Prakash Narayan Bird Sanctuary

Q.17 **In June 2026, a 40-member Indian Army contingent departed to participate in the 23rd edition of Exercise KHAAN QUEST. In which country was this multinational peacekeeping exercise held?**

Ans
- ✓ 1. Mongolia
- ✗ 2. Kyrgyzstan
- ✗ 3. Tajikistan
- ✗ 4. Kazakhstan

Q.18 **Which type of organism causes malaria?**

Ans
- ✗ 1. Virus
- ✗ 2. Fungus
- ✓ 3. Protozoan
- ✗ 4. Bacterium

Q.19 **On 6th February 2026, the ICC Under-19 Cricket World Cup 2026 final was held in which of the following country country?**

Ans
- ✓ 1. Zimbabwe
- ✗ 2. India
- ✗ 3. South Africa
- ✗ 4. England

Q.20 **In August 2026, President Droupadi Murmu conferred the Sangeet Natak Akademi Fellowship (Akademi Ratna) on seven eminent masters of Indian performing arts. Which of the following was among the recipients?**

Ans
- ✗ 1. Dr. Padma Subrahmanyam (Bharatanatyam)
- ✗ 2. Pt. Birju Maharaj (Kathak)
- ✓ 3. Rita Ganguly (Hindustani Vocal)
- ✗ 4. Ustad Zakir Hussain (Tabla)

blackbook

Section : **General Awareness 2**

Q.1 **Dr. B.R. Ambedkar, who served as independent India's first Law Minister, chaired which committee constituted on 29 August 1947?**

Ans
- ✗ 1. Planning Commission of India
- ✓ 2. Drafting Committee of the Constituent Assembly
- ✗ 3. Official Language Commission
- ✗ 4. Linguistic Provinces Commission

Q.2 **What is the main effect of the Himalayan mountains on winter temperatures in northern India ?**

Ans
- ✓ 1. They block cold winds from central Asia
- ✗ 2. They increase the length of winter
- ✗ 3. They bring cool ocean breezes
- ✗ 4. They cause temperature inversion

Q.3 **Under Article 243ZD of the Constitution of India, what is the primary role of the District Planning Committee?**

Ans
- ✓ 1. To consolidate local plans and prepare a draft development plan for the district as a whole
- ✗ 2. To allocate financial grants directly to state-level infrastructure projects across all sectors
- ✗ 3. To resolve boundary, territorial, and revenue disputes arising between adjacent municipalities
- ✗ 4. To conduct elections and oversee seat reservations for urban and rural local bodies in the district

Q.4 **Which of the following is a key feature of tribal settlements in India?**

Ans
- ✗ 1. Absence of territorial affiliation
- ✓ 2. Presence of a strong ethnic identity
- ✗ 3. High degree of occupational specialization
- ✗ 4. Practice of urban industrial occupations

Q.5 **Under Article 163 of the Constitution of India, who determines whether a matter falls within the Governor's constitutional discretion?**

Ans
- ✗ 1. The High Court of the concerned State
- ✗ 2. The Council of Ministers headed by the Chief Minister
- ✓ 3. The Governor, whose decision shall be final
- ✗ 4. The President of India

Q.6 **Under Article 118(3) of the Constitution of India, who is empowered to make rules regarding the procedure of a joint sitting of both Houses of Parliament?**

Ans
- ✗ 1. Parliament by legislation
- ✓ 2. President after consultation
- ✗ 3. Chairman of Rajya Sabha
- ✗ 4. Speaker of Lok Sabha

Q.7 **Which feature in the Preamble of the Indian Constitution signifies that India can conduct its internal and external affairs without interference from any foreign authority?**

Ans
- ✗ 1. Socialist
- ✓ 2. Sovereign
- ✗ 3. Republic
- ✗ 4. Secular

Q.8 **The Karnataka Plateau tapers southward and merges with which of the following hill ranges?**

Ans
- ✓ 1. Nilgiri Hills
- ✗ 2. Western Ghats
- ✗ 3. Vindhya Range
- ✗ 4. Eastern Ghats

Generated by rank.qmaths.in

Q.9 **What does the north-south extent of isotherms parallel to the coast indicate about temperature changes in India's coastal regions during the hot weather season?**

Ans
- ✗ 1. Temperature increases steadily from north to south
- ✗ 2. Temperature remains constant throughout the coast
- ✗ 3. Temperature changes rapidly along the coast
- ✓ 4. Temperature does not decrease from north to south

Q.10 **Which Irish leader associated with the Theosophical Society established the Central Hindu College at Banaras in 1898?**

Ans
- ✗ 1. Sister Nivedita
- ✗ 2. Madam Cama
- ✗ 3. Margaret Cousins
- ✓ 4. Annie Besant

Q.11 **During periods of high inflation in the post-1991 reform era, which fiscal policy measure most directly complemented the Reserve Bank of India's anti-inflationary monetary policy?**

Ans
- ✗ 1. Increase in revenue expenditure through subsidies
- ✗ 2. Increase in capital expenditure financed through higher borrowing
- ✗ 3. Expansion of rural loan waivers
- ✓ 4. Reduction in the fiscal deficit to moderate aggregate demand

Q.12 **Why does Mawsynram receive exceptionally high rainfall during the South-West Monsoon?**

Ans
- ✓ 1. Moist Bay of Bengal monsoon winds are forced to ascend the Khasi Hills.
- ✗ 2. It lies in the rain-shadow region of the Khasi Hills.
- ✗ 3. It experiences continuous convection throughout the year.
- ✗ 4. It receives rainfall mainly from Western Disturbances during winter.

Q.13 **Which best describes India's occupational structure on the eve of independence?**

Ans
- ✓ 1. Overwhelming dependence on agriculture with little mobility
- ✗ 2. Predominant dependence on manufacturing and factory work
- ✗ 3. Balanced dependence across agriculture, industry and services
- ✗ 4. Predominant dependence on services with limited agriculture

Q.14 **Which pedogenic process is primarily responsible for the characteristic fertility and profile renewal of Khadar alluvial soils in northern India?**

Ans
- ✓ 1. Annual inundation depositing fine fresh silt layers.
- ✗ 2. Intense chemical leaching of soluble silica bases.
- ✗ 3. Subsurface calcification forming dense kankar nodules.
- ✗ 4. Upward capillary rise concentrating sodium salts.

Q.15 **Who wrote the Sanskrit drama *Malavikagnimitram*, one of the literary works produced during the Gupta period?**

Ans
- ✓ 1. Kalidasa
- ✗ 2. Vishakhadatta
- ✗ 3. Banabhatta
- ✗ 4. Harisena

Generated by rank.qmaths.in

Q.16 **Which Article provides that no person shall be deprived of his or her property except by authority of law?**

Ans
- ✔ 1. Article 300A
- ✘ 2. Article 31
- ✘ 3. Article 19(1)(f)
- ✘ 4. Article 39(b)

Q.17 **Which tribal movement of 1922–1924 was led by Alluri Sitarama Raju?**

Ans
- ✘ 1. Munda Ulgulan
- ✘ 2. Kol Uprising
- ✔ 3. Rampa Rebellion
- ✘ 4. Santhal Rebellion

Q.18 **Under which constitutional provision can the Union issue directions to a State for ensuring compliance with laws made by Parliament?**

Ans
- ✘ 1. Article 280
- ✘ 2. Article 312
- ✔ 3. Article 256
- ✘ 4. Article 262

Q.19 **In the central administrative structure of the Mughal Empire, which minister served as the head of the imperial revenue department, treasury, and overall financial administration?**

Ans
- ✘ 1. Sadr-us-Sudur
- ✘ 2. Mir Bakshi
- ✘ 3. Qazi-ul-Quzat
- ✔ 4. Diwan-i-Kul

Q.20 **Who was the author of the book *Satyarth Prakash*?**

Ans
- ✔ 1. Swami Dayanand Saraswati
- ✘ 2. Raja Ram Mohan Roy
- ✘ 3. Swami Shraddhanand
- ✘ 4. Swami Vivekananda

Section : **General Intelligence and Reasoning Ability**

Q.1 **A @ B means 'A is the mother of B',**
A + B means 'A is the father of B' and
A % B means 'A is the sister of B'.

If C % M @ Y + T % E, then how is C related to E?

Ans
- ✔ 1. Father's mother's sister
- ✘ 2. Father's mother's mother
- ✘ 3. Father's sister
- ✘ 4. Father's mother

Generated by rank.qmaths.in

Q.2 **Refer to the following number, symbol series and answer the question that follows. Counting to be done from left to right only. (Note: All numbers are single digit numbers only)**
(Left) / 3 + 7 & 9 @ % \ % 5 ^ < / / > / 1 $ + 1 (Right)
How many such symbols are there each of which is immediately preceded by another symbol and also immediately followed by a number?

Ans
✔ 1. Three
✘ 2. Two
✘ 3. Four
✘ 4. One

Q.3 **Seven boxes, A, B, C, D, S, T and U, are kept one over the other but not necessarily in the same order.**
Only two boxes are kept below S. Only one box is kept above U. Only one box is kept between U and D. T is kept immediately above B. A is kept at some place below C.
How many boxes are kept between C and T?

Ans
✘ 1. Three
✘ 2. Two
✔ 3. Four
✘ 4. One

Q.4 **In a certain code language,**
"planner schedule meeting organizes" is coded as "oP sG kR al"
"meeting needs office schedule" is coded as "uH oP al qU"
"schedule coordinates efficient planner" is coded as "oP lV rQ sG"
(all the codes are two letters coded only)
How is 'meeting' coded in the given language?

Ans
✔ 1. al
✘ 2. kR
✘ 3. qU
✘ 4. oP

Q.5 **This question is based on the five, three-digit numbers given below.**
(Left) 321 245 625 468 219 (Right)
(Example: 697 – First digit = 6, second digit = 9 and third digit = 7)
NOTE: All operations to be done from left to right.

What will be the resultant if the second digit of the second highest number is added to the third digit of the second lowest number?

Ans
✘ 1. 9
✘ 2. 10
✘ 3. 8
✔ 4. 11

Q.6 **Select the option that represents the correct order of the given words as they would appear in an English dictionary.**
1. Appears
2. Apple
3. Appoints
4. Apply
5. Applera

Ans
✘ 1. 4, 1, 5, 2, 3
✘ 2. 2, 4, 5, 1, 3
✔ 3. 1, 2, 5, 4, 3
✘ 4. 1, 3, 2, 5, 4

Generated by rank.qmaths.in

Q.7 In a competition, Priya ranked 15th from the top and 22nd from the bottom. How many participants were there in the competition?

Ans
- ✔ 1. 36
- ✘ 2. 37
- ✘ 3. 38
- ✘ 4. 35

Q.8 Mr. Serath starts from Point A and drives 13 km towards East. He then takes a right turn, drives 21 km, turns right and drives 38 km. He then takes a right turn and drives 4 km. He then taken a right turn, drives 20 km, turns left and drives 9 km. He takes a final right turn, drives 5 km and stops at Point P. How far (shortest distance) and towards which direction should he drive in order to reach Point A again? (All turns are 90 degrees turns only unless specified)

Ans
- ✘ 1. 4 km to the East
- ✘ 2. 5 km to the West
- ✘ 3. 7 km to the East
- ✔ 4. 8 km to the North

Q.9 The position(s) of how many letters will remain unchanged if each letter in the word DYNAMIC is arranged in the English alphabetical order?

Ans
- ✔ 1. 1
- ✘ 2. None
- ✘ 3. 2
- ✘ 4. 3

Q.10 S, T, U, V, W, X, Y and Z are sitting around a circular table facing the centre. Y sits to the immediate right of Z. Z sits second to the right of X. W is an immediate neighbour of S and X. U is not an immediate neighbour of Z. Exactly three people sit between U and V when counted from the right of V.
How many people sit between U and Y when counted from the left of U?

Ans
- ✘ 1. Two
- ✘ 2. Four
- ✔ 3. One
- ✘ 4. Three

Q.11 In a certain code,
'chair sofa table' is coded as 'lu ke rm'
'table bed shelf' is coded as 'rm px gt'
'shelf chair mirror' is coded as 'cn lu gt'
(all the codes are two-letter codes only)
What is the code for the word 'mirror'?

Ans
- ✔ 1. cn
- ✘ 2. ke
- ✘ 3. lu
- ✘ 4. gt

Q.12 Seven boxes, A, B, C, D, E, F and G, are kept one over the other but not necessarily in the same order.
A is kept second from the bottom. Only three boxes are kept between A and G. D is kept at one of the positions below A. Only E is kept between G and F. B is kept at one of the positions above G.
How many boxes are kept between D and F?

Ans
- ✔ 1. 2
- ✘ 2. 4
- ✘ 3. 3
- ✘ 4. 1

Black book

Q.13 **Which of the following letter-clusters should replace # and % so that the pattern and relationship followed between the letter-cluster pair on the left side of :: is the same as that on the right side of :: ?**
 # : LTQ :: EMJ : %

Ans
- ✗ 1. # = RQU , % = DPM
- ✗ 2. # = MUV , % = GLP
- ✓ 3. # = NVS , % = CKH
- ✗ 4. # = KUS , % = FON

Q.14 **Refer to the following letter, number, symbol series and answer the question. All numbers are single-digit numbers.**
(Left) L 7 ! D Q 6 € B & 5 P @ R 2 * F 8 W # 4 H © (Right)
If all the numbers are dropped from the series, which of the following will be sixth from the left?

Ans
- ✗ 1. *
- ✓ 2. B
- ✗ 3. R
- ✗ 4. &

Q.15 **Select the pair which follows the same pattern as that followed by the two pairs given below. Both pairs follow the same pattern.**
GAM : EYK
SCV : QAT

Ans
- ✗ 1. BVN :ZSL
- ✓ 2. LKD : JIB
- ✗ 3. TEX : QCU
- ✗ 4. PYI : NXG

Q.16 **Q, A, Z, W, S, X and E are sitting around a circular table facing the centre.**
Only two people sit between X and W when counted from the left of W. E sits third to the left of A. Z sits to the immediate right of A. Z sits second to the left of X. S is an immediate neighbour of E.
How many people sit between A and E when counted from the left of A?

Ans
- ✗ 1. 4
- ✓ 2. 2
- ✗ 3. 1
- ✗ 4. 3

Q.17 **Each of P, I, C, T, U, R and E has an exam on a different day of a week starting from Monday and ending on Sunday of the same week.**
T has exam on Thursday and R has exam on Saturday. C has exam immediately before U.
I has exam on one of the days after P. E has exam immediately after U.
Who has exam on the last day of the week?

Ans
- ✗ 1. R
- ✓ 2. I
- ✗ 3. P
- ✗ 4. E

Q.18 **Refer to the following letter, symbol series and answer the question.**
(Left) E Y ^ ! Q * O L $ M A # T @ & K D % R U (Right)
If all the letters are dropped from the series, which of the following will be fifth from the right?

Ans
- ✗ 1. #
- ✗ 2. *
- ✓ 3. $
- ✗ 4. @

Generated by rank.qmaths.in

Q.19 **Karan is the son of Sunita. Sunita is the sister of Mahesh. Mahesh is the father of Pooja. Pooja is the wife of Nitin. How is Karan related to Nitin?**

Ans

✔ 1. Wife's father's sister's son

✘ 2. Wife's mother's sister's son

✘ 3. Wife's father's brother's son

✘ 4. Wife's mother's brother's son

Q.20 **This question is based on the following words**
FIG SUM LIT COB
If in each of the words, each letter is changed to the immediate next letter in the English alphabetical order, how many words thus formed will have no vowel?

Ans

✘ 1. Four

✘ 2. One

✘ 3. Two

✔ 4. Three

Section : **General Intelligence and Reasoning Ability 2**

Q.1 **In this question, a question is followed by two statements numbered (I) and (II). You have to decide whether the data provided in the statements are sufficient to answer the question. Read both the statements and decide the appropriate answer.**
Among 5 sticks, W, M, R, J and K each having a different height, which stick is the tallest?
(I) W is taller than J but shorter than K. W is shorter than only one stick
(II) J is taller than M

Ans

✘ 1. Data in Statement II alone is sufficient to answer the question while data in statement I is not

✘ 2. Both statements I and II together (and not statement I alone or statement II alone) are sufficient to answer the question.

✔ 3. Data in Statement I alone is sufficient to answer the question while data in statement II is not

✘ 4. Both statements I and II together are NOT sufficient to answer the question

Q.2 **Select the correct mirror image of the given combination when the mirror is placed at 'MN' as shown below.**

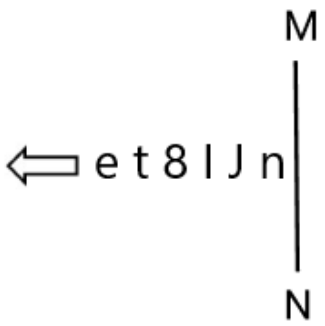

Ans

✘ 1. 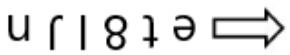

✘ 2. 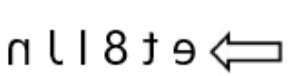

✔ 3. 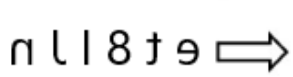

✘ 4. 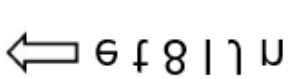

Q.3 **Select the Venn diagram that best illustrates the relationship between the following classes.**

Books, Shelves, Furniture

Ans

✗ 1.

✗ 2.

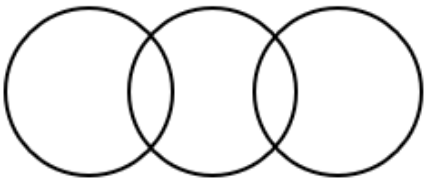

✗ 3.

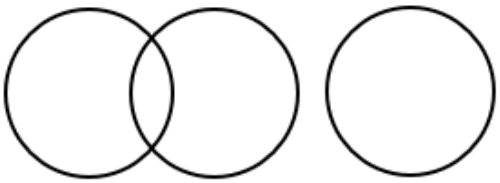

✓ 4.

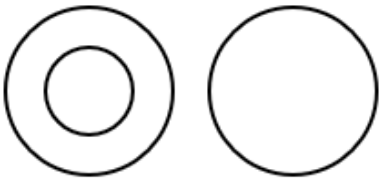

Q.4 **What should come in place of '?' in the given series?**
128, 139, 161, 194, 238, ?

Ans

✓ 1. 293

✗ 2. 291

✗ 3. 297

✗ 4. 295

Q.5 **What should come in place of '?' in the given series?**
83 71 59 47 35 ?

Ans

✓ 1. 23

✗ 2. 22

✗ 3. 20

✗ 4. 21

Q.6 **What will come in the place of '?' in the following equation, if '+' and '-' are interchanged and 'x' and '÷' are interchanged?**
28 ÷ 4 - 19 + 12 x 2 = ?

Ans

✗ 1. 124

✗ 2. 122

✓ 3. 125

✗ 4. 123

Generated by rank.qmaths.in

Q.7 **Select the set in which the numbers are related in the same way as are the numbers of the following sets.**
(NOTE: Operations should be performed on the whole numbers, without breaking down the numbers into its constituent digits. E.g. 13 – Operations on 13 such as adding/subtracting/multiplying etc. to 13 can be performed. Breaking down 13 into 1 and 3 and then performing mathematical operations on 1 and 3 is not allowed)
(15, 460, 9)
(30, 910, 24)

Ans
✗ 1. (32, 980, 26)
✓ 2. (28, 860, 22)
✗ 3. (27, 830, 21)
✗ 4. (31, 940, 25)

Q.8 **A question is followed by two statements numbered (I) and (II). You have to decide whether the data provided in the statements are sufficient to answer the question. Read both the statements and decide the appropriate answer.**
Among 5 sticks, K, B, R, N and Y each having a different height, which stick is the shortest?
(I) Y is shorter than B. N is shorter than K.
(II) N is taller than Y.

Ans
✗ 1. Both statements I and II together (and not statement I alone or statement II alone) are sufficient to answer the question.
✓ 2. Both statements I and II together are NOT sufficient to answer the question
✗ 3. Data in Statement I alone is sufficient to answer the question while data in statement II is not
✗ 4. Data in Statement II alone is sufficient to answer the question while data in statement I is not

Q.9 **Select the option figure in which the given figure (X) is embedded as its part (rotation is NOT allowed).**

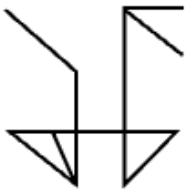

(X)

Ans
✗ 1. 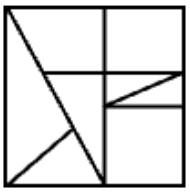
✗ 2. 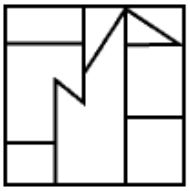
✗ 3. 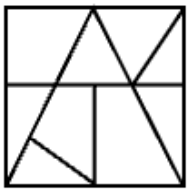
✓ 4. 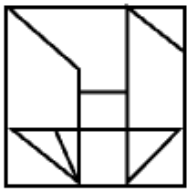

Blackbook

Q.10 **Which of the following letter-number clusters will replace the question mark (?) in the given series to make it logically complete?**

KOP 70 NRS 82 QUV 94 TXY 106 ?

Ans
- ✗ 1. WZA 117
- ✓ 2. WAB 118
- ✗ 3. WBA 118
- ✗ 4. WBH 117

Q.11 **Based on the English alphabetical order, three of the following four letter-cluster pairs are alike in a certain way and thus form a group. Which is the one that does not belong to that group?**
(Note: The odd one out is not based on the number of consonants/vowels or their position in the letter cluster.)

Ans
- ✗ 1. WW-FA
- ✗ 2. HH-QL
- ✗ 3. ZZ-ID
- ✓ 4. FF-JO

Q.12 **Based on the English alphabetical order, three of the following four are alike in a certain way and thus form a group. Which is the one that does not belong to that group?**
(Note: The odd man out is not based on the number of consonants/vowels or their position in the letter-cluster.)

Ans
- ✗ 1. BGL
- ✗ 2. AFK
- ✗ 3. UZE
- ✓ 4. LNO

Q.13 **16 is related to 83 following a certain logic. Following the same logic, 9 is related to 48. To which of the following is 21 related to, following the same logic?**

Ans
- ✗ 1. 124
- ✗ 2. 112
- ✗ 3. 129
- ✓ 4. 108

Q.14 **Read the given statements and conclusions carefully. You have to take the given statements to be true even if they seem to be at variance from commonly known facts. You have to decide which conclusion/s logically follow/s from the given statements**
Statements: Some chairs are desks. No desk is a table. No table is a belt.
Conclusions (I) : No chair is a table.
Conclusions (II) : No desk is a belt.

Ans
- ✗ 1. Both conclusions (I) and (II) follow
- ✗ 2. Only conclusion (II) follows
- ✗ 3. Only conclusion (I) follows
- ✓ 4. Neither conclusion (I) nor (II) follows

Generated by rank.qmaths.in

Q.15 **Select the Venn diagram that best illustrates the relationship between the following classes.**
Dog, Cat, Parrot

Ans

✗ 1.
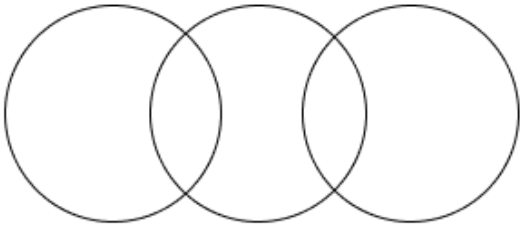

✗ 2.
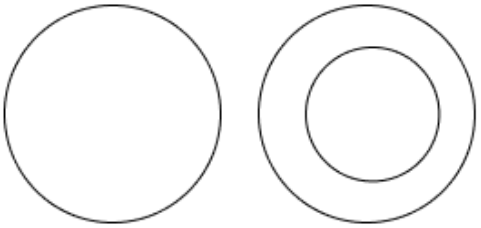

✗ 3.
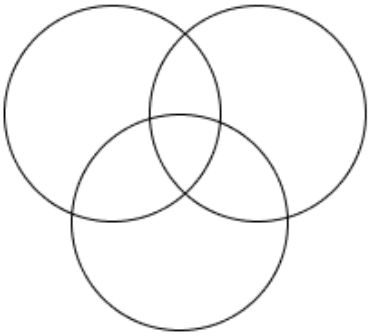

✓ 4.


Q.16 **What should come in place of '?' in the given series?**
174 177.8 181.6 185.4 189.2 ?

Ans

✗ 1. 194.2

✓ 2. 193

✗ 3. 195.4

✗ 4. 192.6

Q.17 **If 'I' stands for '+' , 'J' stands for '×', 'K' stands for '÷', and 'L' stands for '-' what will come in place of the question mark '?' in the following equation?**
15 I 18 K 2 L 7 J 2 I 22 = ?

Ans

✗ 1. 28

✗ 2. 40

✗ 3. 48

✓ 4. 32

Generated by rank.qmaths.in

Q.18 **Select the correct mirror image of the given figure when the mirror is placed at MN as shown below.**

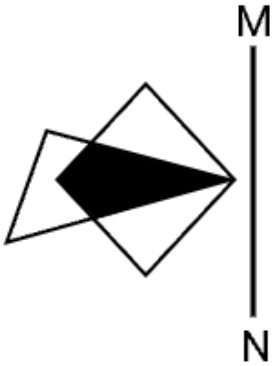

Ans

✗ 1. 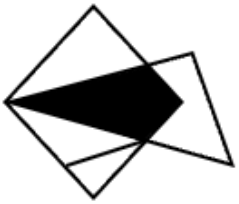

✗ 2. 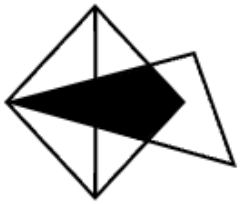

✓ 3. 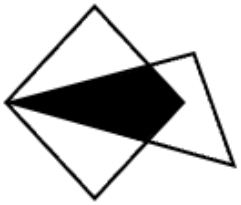

✗ 4. 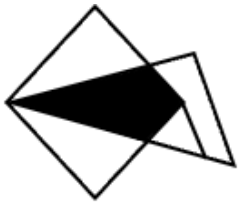

Q.19 **If 'P' stands for '−', 'Q' stands for '÷', 'R' stands for '×' and 'S' stands for '+', then the resultant of which of the following would be 331?**

Ans

✗ 1. 39 R 5 P 9 S 3 Q 99

✗ 2. 39 P 5 Q 9 R 3 S 99

✓ 3. 39 P 5 S 9 Q 3 R 99

✗ 4. 39 Q 5 S 9 P 3 R 99

Q.20 **23 is related to 528 following a certain logic. Following the same logic, 2 is related to 3. To which of the following is 18 related, following the same logic?**
(NOTE: Operations should be performed on the whole numbers, without breaking down the numbers into its constituent digits. E.g. 13 – Operations on 13 such as adding / subtracting /multiplying etc. to 13 can be performed. Breaking down 13 into 1 and 3 and then performing mathematical operations on 1 and 3 is not allowed)

Ans

✓ 1. 323

✗ 2. 324

✗ 3. 321

✗ 4. 326

Blackbook

Section : **Arithmetical and Numerical Ability**

Q.1 **Which of the following numbers must be subtracted from 46271 to make it divisible by 11?**

Ans
✗ 1. 4
✓ 2. 5
✗ 3. 3
✗ 4. 2

Q.2 **What will be the least natural number which when doubled will be exactly divisible by 12, 18 and 21?**

Ans
✗ 1. 136
✗ 2. 252
✗ 3. 130
✓ 4. 126

Q.3 **Find the smallest natural number which when increased by 10 is completely divisible by 12, 15 and 18.**

Ans
✗ 1. 150
✗ 2. 160
✓ 3. 170
✗ 4. 180

Q.4 **Which of the following is the correct vulgar fraction equivalent of the mixed recurring decimal 0.312666666666...?**

Ans
✗ 1. $\frac{321}{1500}$
✓ 2. $\frac{469}{1500}$
✗ 3. $\frac{312}{1500}$
✗ 4. $\frac{2817}{9000}$

Q.5 **Two banks, A and B, offered loans at 4% and 6.5% per annum, respectively. Shivam borrowed an amount of ₹2,20,000 from each bank. Find the positive difference (in ₹) between the amounts of simple interest paid to the two banks by Shivam after 3 years.**

Ans
✗ 1. 18,000
✗ 2. 17,500
✓ 3. 16,500
✗ 4. 16,000

Q.6 **The average weight of all children in a group is 37 kg. If 6 children with an average weight of 26 kg leave the group and 4 children with an average weight of 23 kg join the group, the average weight of the children in the group increases by 1 kg. The number of children in the group initially was:**

Ans
✗ 1. 15
✗ 2. 13
✗ 3. 14
✓ 4. 12

Generated by rank.qmaths.in

Q.7 **The ratio of boys to girls in a class is 7 : 5. If 14% of the boys and 20% of the girls are absent, what is the ratio of present boys to present girls?**

Ans
✔ 1. 301:200
✘ 2. 341:200
✘ 3. 323:200
✘ 4. 279:200

Q.8 **The table below shows the monthly expenses of four departments in a company.**

Department	Monthly expenses (₹)
Marketing	500
Sales	800
HR	600
IT	300

If the company reduces the Marketing expense by 10% and increases the HR expense by 20%, what will be the combined expenses of these two departments?

Ans
✔ 1. ₹1,170
✘ 2. ₹1,070
✘ 3. ₹1,270
✘ 4. ₹1,370

Q.9 **A person purchases a laptop for ₹48,000 and agrees to pay the amount in two equal annual installments. The company charges compound interest at 10% per annum, compounded annually on the outstanding balance. If the first installment is paid at the end of the first year, what is the value of each installment? (Round off your answer to the nearest rupee)**

Ans
✘ 1. ₹27,756
✘ 2. ₹27,567
✘ 3. ₹27,675
✔ 4. ₹27,657

Q.10 **What is the value of $(49^8 \times 343^5 \times 7^6) \div 2401^6$?**

Ans
✘ 1. 7^{10}
✔ 2. 7^{13}
✘ 3. 7^{11}
✘ 4. 7^{12}

Q.11 **A person borrows ₹21,500 and agrees to repay it in 4 equal annual installments at 5% simple interest. Find each installment.**

Ans
✘ 1. ₹4,500
✔ 2. ₹6,000
✘ 3. ₹5,000
✘ 4. ₹4,000

Q.12 **A college conducted an election for the position of Student President. Out of 1,200 eligible students, 15% did not vote. Among those who voted, 60 votes were declared invalid. What was the total number of valid votes?**

Ans
✘ 1. 1,060
✔ 2. 960
✘ 3. 1,020
✘ 4. 940

Generated by rank.qmaths.in

Q.13 **If the LCM of two natural numbers a and b is $2^5 \times 3^4 \times 5^3$ and their HCF is $2^2 \times 3^2 \times 5$, how many pairs of (a, b) satisfy these conditions?**

Ans
- ✔ 1. 8
- ✘ 2. 10
- ✘ 3. 12
- ✘ 4. 6

Q.14 **A sum of ₹8,000 is compounded annually at a rate of 5% per annum for 3 years. What is the total compound interest accrued?**

Ans
- ✘ 1. ₹1,320
- ✔ 2. ₹1,261
- ✘ 3. ₹1,250
- ✘ 4. ₹1,450

Q.15 **A company's annual expenditure on different sectors is represented in the following pie chart:**

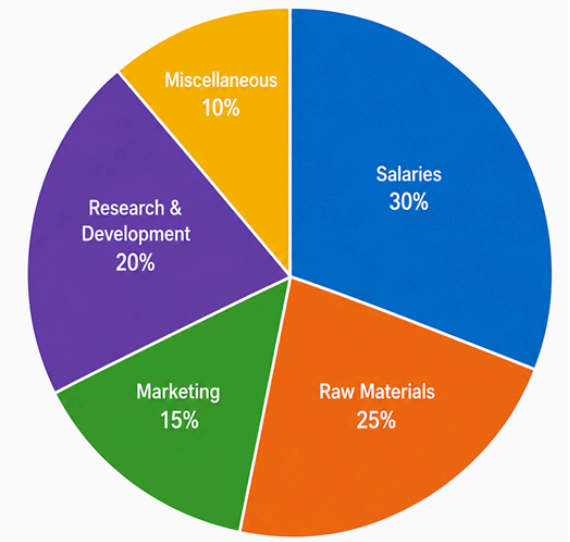

If the total annual expenditure is ₹20,00,000, what is the difference (in ₹) between the amounts spent on Raw Materials and Marketing?

Ans
- ✘ 1. ₹1,80,000
- ✘ 2. ₹1,00,000
- ✘ 3. ₹50,000
- ✔ 4. ₹2,00,000

Q.16 **A person borrows ₹2,20,000 at 13% compound interest per annum, compounded annually. He repays ₹55,000 at the end of the first year and ₹65,000 at the end of the second year. Find the outstanding balance immediately after the second year.**

Ans
- ✔ 1. ₹1,53,768
- ✘ 2. ₹1,43,158
- ✘ 3. ₹1,57,314
- ✘ 4. ₹1,48,634

Q.17 **The average score of 7 students in a quiz is 72. When the top scorer leaves, the average becomes 68. What was the score of the top scorer?**

Ans
- ✔ 1. 96
- ✘ 2. 98
- ✘ 3. 92
- ✘ 4. 94

Generated by rank.qmaths.in

Q.18 **Study the following bar graph and answer the question given below.**
The bar graph given below shows the production of fertilizers by a company (in 10000 tonnes) over the years.

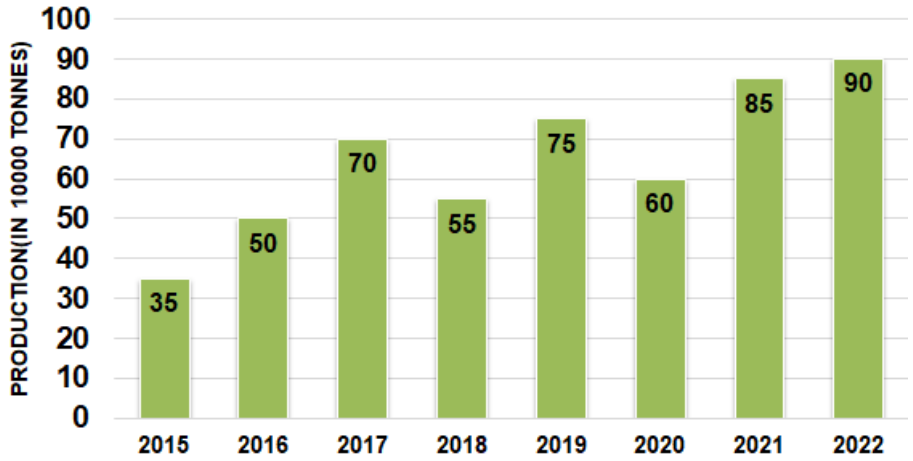

What was the percentage increase in production of fertilizers in 2022 compared to that in 2020?

Ans
✗ 1. 60%
✗ 2. 40%
✓ 3. 50%
✗ 4. 30%

Q.19 Evaluate: $144 \div (12 \div 3) \times [5 - (2 + 1)]$

Ans
✓ 1. 72
✗ 2. 76
✗ 3. 70
✗ 4. 74

Generated by rank.qmaths.in

Q.20 **The pie chart given below shows the percentage distribution of 2000 employees in different departments. The bar graph given shows the percentage of female employees.**

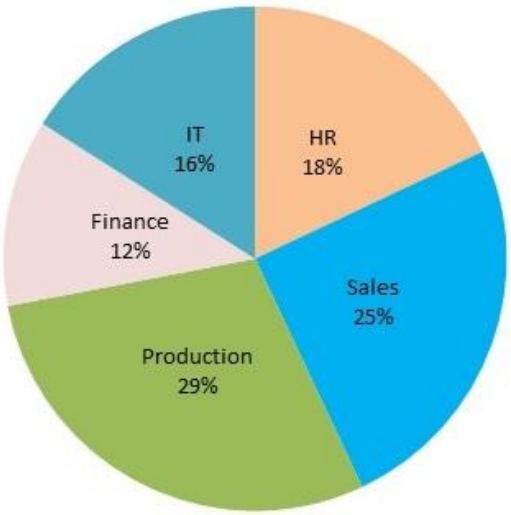

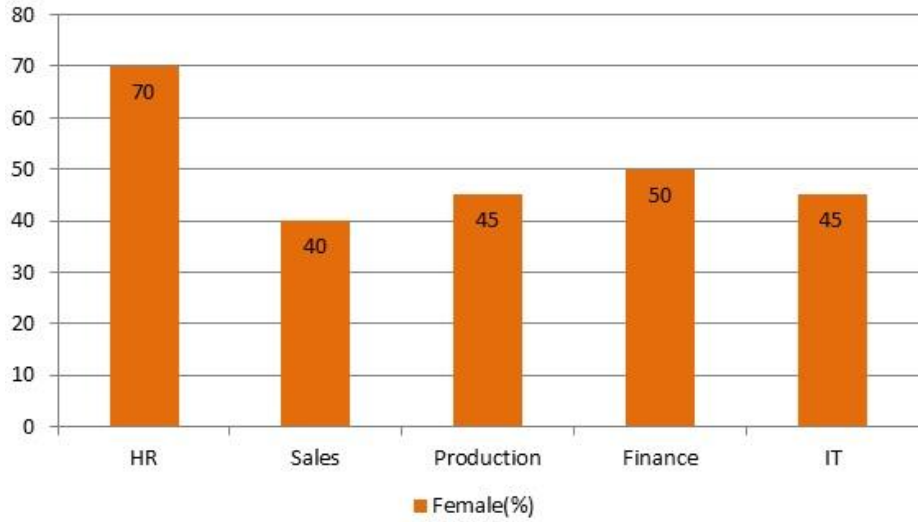

If we combine the HR and Finance departments, what is the total number of female employees in these two departments?

Ans

✗ 1. 318

✓ 2. 372

✗ 3. 480

✗ 4. 252

Section : **Arithmetical and Numerical Ability 2**

Q.1 **A chemist mixes acid and water to prepare a solution weighing 34 kg. If the mean proportional between the weights of acid and water is 15 kg, then what is the weight of acid in the mixture, assuming the weight of acid is less than the weight of water?**

Ans

✓ 1. 9 kg

✗ 2. 15 kg

✗ 3. 16 kg

✗ 4. 25 kg

Generated by rank.qmaths.in

Q.2 A research laboratory is constructing a soundproof hollow hemispherical dome having an external radius of 12 m and a uniform wall thickness of 1.5 m. The external curved surface is to be coated with a highly reflective film costing ₹240 per m^2, while the internal curved surface is to be lined with a sound-absorbing material costing ₹300 per m^2. The circular base is not to be covered. The total cost of lining the two curved surfaces, is (Use $\pi = 3.14$)

Ans
- ✗ 1. ₹4,34,747.80
- ✓ 2. ₹4,24,747.80
- ✗ 3. ₹4,25,747.80
- ✗ 4. ₹4,35,747.80

Q.3 A passenger drone flies at a steady speed of 15 km/h. It completes a trip in 5 hours between two outposts. What is the distance covered by the drone?

Ans
- ✗ 1. 15 km
- ✗ 2. 60 km
- ✗ 3. 30 km
- ✓ 4. 75 km

Q.4 A delivery van moves for 15 minutes at 28 km/h and then for another 15 minutes at 44 km/h. What is the average speed of the van for the entire journey?

Ans
- ✓ 1. 36 km/h
- ✗ 2. 28 km/h
- ✗ 3. 32 km/h
- ✗ 4. 44 km/h

Q.5 A television is priced at ₹20,000 in a store. If the store offers successive discounts of 25% and 30%, what will be the final selling price?

Ans
- ✗ 1. ₹10,400
- ✗ 2. ₹10,600
- ✗ 3. ₹10,200
- ✓ 4. ₹10,500

Q.6 A chef prepares a 36 kg solution by mixing salt and water. The ratio of salt to water is kept the same for all future batches. If the mean proportional of the weights of salt and water is 12 kg, and the amount of salt is less than the amount of water, what is the weight (in kg) of salt in the original mixture?

Ans
- ✗ 1. $18+6\sqrt{3}$
- ✗ 2. $18-6\sqrt{3}$
- ✗ 3. $18+6\sqrt{5}$
- ✓ 4. $18-6\sqrt{5}$

Q.7 Two trains A and B are moving in the same direction on parallel tracks. Train A is 40% longer than Train B. Train A completely overtakes Train B in 36 seconds. If the speeds of Train A and Train B are 90 km/h and 54 km/h respectively, find the length of the longer train.

Ans
- ✗ 1. 180 m
- ✓ 2. 210 m
- ✗ 3. 150 m
- ✗ 4. 240 m

Generated by rank.qmaths.in

Q.8 **A company manufactures a product at a cost of ₹60,000 and sells it to a dealer at a profit of 30%. The dealer then sells the product to a retailer at a profit of x%. Finally, the retailer sells the product to the end customer at a profit of 20%. If the final selling price paid by the customer is ₹1,07,640, find the value of x.**

Ans
✔ 1. 15
✘ 2. 25
✘ 3. 10
✘ 4. 20

Q.9 **A reservoir can be filled by two inlet pipes P and Q in 20 hours and 30 hours, respectively, while an outlet pipe R can empty the full reservoir in 60 hours. The pipes are operated according to a fixed schedule: P and Q are opened together for the first 5 hours, followed by Q and R for the next 10 hours, and finally P and R are opened together until the reservoir is completely filled. Find the total time required to fill the reservoir.**

Ans
✘ 1. 22.5
✔ 2. 27.5
✘ 3. 30.5
✘ 4. 12.5

Q.10 **A dealer purchases a refrigerator with a marked price of ₹75,000. The company offers a 15% scheme discount and an additional 8% cash discount on the discounted price for immediate payment. The dealer further spends ₹2,400 on transportation and sells the refrigerator for ₹70,000. Find the dealer's profit percentage. (Round off your answer to two decimal places)**

Ans
✘ 1. 15.23%
✘ 2. 13.33%
✔ 3. 14.66%
✘ 4. 16.67%

Q.11 **A furniture item is offered with two successive discounts of 20% and 10%. The overall reduction in price amounts to ₹280. What is the marked price (in ₹) of the furniture item?**

Ans
✔ 1. ₹1,000
✘ 2. ₹1,300
✘ 3. ₹1,100
✘ 4. ₹1,200

Q.12 **A bespoke laboratory needs two chemical solutions, X and Y, to prepare a specialized reagent.**
The volume of solution X is directly proportional to the square of the weight of compound A.
The volume of solution Y is inversely proportional to the cube of the weight of compound B.
When 4 g of compound A and 2 g of compound B are used, the laboratory requires 16 ml of X and 8 ml of Y, respectively. If the technician instead uses 6 g of A and 4 g of B, how much total solution (X + Y) is required?

Ans
✘ 1. 34 ml
✘ 2. 38 ml
✘ 3. 28 ml
✔ 4. 37 ml

Q.13 **1% of 41% of a number is what percentage of that number?**

Ans
✘ 1. 41%
✔ 2. 0.41%
✘ 3. 42%
✘ 4. 0.42%

Generated by rank.qmaths.in

Q.14 **A mixture contains walnuts, pistachios, and dates in the ratio 6 : 3 : 5 by weight. The total weight of the mixture is 28 kg, and the mixture is thoroughly mixed before being divided equally into 2 kg packs. How many kilograms of walnuts are present in 7 packs?**

Ans
- ✗ 1. 8.4 kg
- ✗ 2. 7.2 kg
- ✓ 3. 6.0 kg
- ✗ 4. 9.0 kg

Q.15 **A shopkeeper purchases a laptop for ₹48,000 and spends ₹2,000 on transportation and installation. He sells the laptop for ₹60,000. What is his profit percentage?**

Ans
- ✓ 1. 20%
- ✗ 2. 15%
- ✗ 3. 25%
- ✗ 4. 10%

Q.16 **A decorative cone-shaped structure has a base radius of 14 cm and a slant height of 50 cm. The curved surface of the structure is painted at the rate of ₹3 per cm^2, while the circular base is covered with a different material costing ₹2 per cm^2. Find the total cost required to complete the mentioned work. (Use $\pi = \frac{22}{7}$)**

Ans
- ✓ 1. ₹7832
- ✗ 2. ₹7382
- ✗ 3. ₹7823
- ✗ 4. ₹7238

Q.17 **A dealer buys a batch of goods for ₹6,000. He sells 40% of the goods at a 25% profit, 30% at a 10% loss, and the rest at cost price. What is the total selling price?**

Ans
- ✓ 1. ₹6,420
- ✗ 2. ₹6,320
- ✗ 3. ₹6,220
- ✗ 4. ₹6,120

Q.18 **The price of fuel decreases by 45%, 50% and 45% in three successive months, but increases by 65% in the fourth month. What is the percentage decrease in the price of fuel in the fourth month as compared to its original price? (Rounded off to the nearest integer)**

Ans
- ✗ 1. 72%
- ✗ 2. 69%
- ✗ 3. 78%
- ✓ 4. 75%

Q.19 **A rectangular playground has dimensions of 40 m by 25 m. A triangular portion is cut off from one corner of the playground for landscaping purposes. The triangular cut-out has a base of 10 m and a height of 8 m. What is the area of the remaining playground after removing the triangular section?**

Ans
- ✗ 1. 1040 m^2
- ✗ 2. 1000 m^2
- ✓ 3. 960 m^2
- ✗ 4. 920 m^2

Generated by rank.qmaths.in

Q.20 A research team is assigned to complete a data analysis project. Team A can complete the project alone in 22 hours, while Team B can complete the same project alone in 33 hours. The teams work alternately for 2 hours each, beginning with Team A. How many hours will it take to complete the project?

Ans
- ✗ 1. 28 hours
- ✗ 2. 31 hours
- ✓ 3. 26 hours
- ✗ 4. 22 hours

Section : **Hindi Language and Comprehension**

Q.1 निम्नलिखित वाक्य में रिक्त स्थान की पूर्ति के लिए दिए गए विकल्पों में से उचित कारक चिह्न चुनिए-
चूहा बिल ---- बाहर निकला।

Ans
- ✗ 1. में
- ✓ 2. से
- ✗ 3. पर
- ✗ 4. द्वारा

Q.2 लोकोक्ति का सही अर्थ क्या होगा?
कढ़ी में कोयला

Ans
- ✓ 1. किसी अच्छी वस्तु में कोई बुरी वस्तु का मिलना
- ✗ 2. स्वादिष्ट भोजन में अनेक प्रकार के मसाले डालना
- ✗ 3. किसी खराब वस्तु को सुंदर बनाना
- ✗ 4. खराब वस्तु का और खराब हो जाना

Q.3 दिए गए वाक्यों के लिखने का सही क्रम चुनें -
(1)गणेश प्रतिदिन सिंध नदी में नहाने के लिए जाता था।
(2)सिंध घाटी में सोनमर्ग नाम का एक कस्बा था।
(3)उस कस्बे में गणेश नाम का एक हाथी रहता था।
(4)लौटते समय एक दर्जी उसे रोज केले खिलाता था।

Ans
- ✗ 1. 3241
- ✗ 2. 2413
- ✗ 3. 1342
- ✓ 4. 2314

Q.4 "नाटक का एक हास्य रस प्रधान भेद" वाक्यांश के लिए सार्थक शब्द क्या होगा?

Ans
- ✗ 1. संस्मरण
- ✗ 2. प्रचारित
- ✓ 3. प्रहसन
- ✗ 4. प्राकृतिक

Q.5 उपयुक्त 'क्रिया-विशेषण' का चयन कर रिक्त स्थान की पूर्ति कीजिए।
'मैं मीटिंग में .....अपना विचार रखती हूँ।'

Ans
- ✗ 1. जल्दी-जल्दी
- ✗ 2. धड़ाधड़
- ✗ 3. दिन -रात
- ✓ 4. सोच -समझकर

Generated by rank.qmaths.in

Q.6 निम्नलिखित वाक्य-खंडों का क्रम सही कीजिए-
अ. जब किसी देश या समाज के लोग
ब. अपने अधिकारों की रक्षा और अन्याय के
स. विरोध के लिए एकजुट होकर शांतिपूर्ण संघर्ष
द. करते हैं, तब उसे जनआन्दोलन कहा जाता है

Ans
✗ 1. स, अ, ब, द
✓ 2. अ, ब, स, द
✗ 3. द, अ, स, ब
✗ 4. ब, अ, द, स

Q.7 लोकोक्ति का सही अर्थ क्या होगा?
कथनी से करनी बड़ी

Ans
✗ 1. काम करना आसान है, बखान कठिन है
✗ 2. किसी कार्य को बिना सोचे-विचारे शुरू करना
✗ 3. केवल बड़ी बातों से सफलता प्राप्त होना
✓ 4. कहने से करना बहुत अच्छा होता है

Q.8 निम्नलिखित मुहावरे का अर्थ बताएं -
'चार चाँद लगना'

Ans
✗ 1. हानि उठाना
✓ 2. शोभा बढ़ना
✗ 3. धोखा करना
✗ 4. धनी होना

Q.9 दिए गए वाक्य में सम्प्रदान कारक का चयन करके रिक्त स्थान की पूर्ति करें-

नियोक्ताओं को प्रोत्साहित करने ---------प्रधानमंत्री रोजगार प्रोत्साहन योजना शुरू की गई ।

Ans
✓ 1. के लिए
✗ 2. ने
✗ 3. में
✗ 4. का

Q.10 निम्नलिखित में से अशुद्ध वर्तनी वाले वाक्य की पहचान करें।

Ans
✗ 1. लालफीताशाही की प्रवृत्ति प्रशासनिक कार्यों की गति को अत्यंत धीमा करती है।
✗ 2. प्रत्यक्ष विदेशी निवेश की नीतियाँ घरेलू उद्योगों के हितों को प्रभावित करती हैं।
✗ 3. आत्म-साक्षात्कार की तड़प ही मनुष्य को सांसारिक मोहमाया से विरक्त करती है।
✓ 4. भावनात्मक बुद्धिमत्ता नैतृत्व क्षमता को निखारने का एक आत्यंत महत्वपूर्ण गुण है।

Q.11 उचित क्रिया-विशेषण का प्रयोग कर वाक्य पूर्ण करें-
आतंकवादियों ने रात में सेना की चौकी पर हमला किया।

Ans
✗ 1. तभी
✓ 2. अचानक
✗ 3. सदा
✗ 4. अभी

Q.12 दिए गए वाक्यांश के लिए सार्थक शब्द चुनिए।
' ऊपर की ओर जानेवाली '

Ans
✗ 1. अवरोही
✗ 2. पतनशील
✗ 3. निम्नगामी
✓ 4. ऊर्ध्वगामी

Generated by rank.qmaths.in

Q.13 नीचे दिए गये वाक्य में उचित क्रिया-विशेषण शब्द का प्रयोग कर वाक्य पूर्ण करें।
कई चरणों में किए गए संशोधनों के परिणामस्वरूप शोध-प्रबंध की भाषा और तर्क-प्रणाली परिष्कृत होती गई।

Ans
✔ 1. अधिक
✘ 2. अचानक
✘ 3. तत्काल
✘ 4. ज्यों-त्यों

Q.14 दिए गए वाक्य के किस भाग में त्रुटि है?
मानव जीवन अंतहीन आकाँक्षाओं, सामाजिक अंतःक्रियाओं और आत्म-मूल्यांकन का एक जटिल ताना-बाना है।

Ans
✘ 1. और आत्म-मूल्यांकन का
✔ 2. मानव जीवन अंतहीन आकाँक्षाओं,
✘ 3. एक जटिल ताना-बाना है।
✘ 4. सामाजिक अंतःक्रियाओं

Q.15 निम्नलिखित वाक्य-खंडों का क्रम सही कीजिए-
अ. जब रसोई में खट्टे
ब. किया जाता है, तब साधारण
स. दही का उचित उपयोग
द. भोजन भी विशेष बन जाता है

Ans
✘ 1. अ, ब, द, स
✔ 2. अ, स, ब, द
✘ 3. स, अ, द, ब
✘ 4. द, अ, स, ब

Q.16 दिए गये विकल्पों में से "मक्खियाँ मारना" मुहावरे के लिए उपयुक्त अर्थ का चयन करें-

Ans
✔ 1. बेकार रहना
✘ 2. खिन्न होना
✘ 3. उदास हो जाना
✘ 4. संशय होना

Q.17 "जो प्रमाण से सिद्ध हो सके" वाक्यांश के लिए सार्थक शब्द क्या होगा?

Ans
✘ 1. पारंगत
✘ 2. प्रकाश्य
✔ 3. प्रमेय
✘ 4. परिचित

Q.18 निम्नलिखित में से कौन-सा मुहावरा बाकी तीनों से अलग अर्थ रखता है?

Ans
✔ 1. दाँत खट्टे करना
✘ 2. रफूचक्कर होना
✘ 3. नौ दो ग्यारह होना
✘ 4. चंपत होना

Q.19 निम्नलिखित वाक्य में उपयुक्त क्रिया का चयन कर रिक्त स्थान की पूर्ति कीजिए।
नगर विकास प्राधिकरण ने मानसून प्रारंभ होने से पूर्व नागरिकों की सुरक्षा तथा सुचारु यातायात व्यवस्था सुनिश्चित करने के उद्देश्य से नगर की सभी प्रमुख सड़कों के क्षतिग्रस्त भागों की मरम्मत निर्धारित समय-सीमा के भीतर _____।

Ans
✘ 1. करेगा
✘ 2. की
✔ 3. करवाई
✘ 4. करता है

Generated by rank.qmaths.in

Q.20 "जिसने मृत्यु को जीत लिया हो" वाक्यांश के लिए सार्थक शब्द क्या होगा?

Ans
- ✗ 1. मेघनाद
- ✓ 2. मृत्युंजय
- ✗ 3. मर्मज्ञ
- ✗ 4. मुमूर्षा

Section : **Hindi Language and Comprehension 2**

Q.1 'उत्तिष्ठ' के लिए उपयुक्त तद्भव शब्द दिए गए विकल्पों में से चुनिए -

Ans
- ✓ 1. उठ
- ✗ 2. उल्लू
- ✗ 3. ऊँट
- ✗ 4. उज्जैन

Q.2 "स्वतंत्रता दिवस के अवसर पर नागरिक बड़ी संख्या में एकत्र होकर समारोह में सम्मिलित हुए।" उपर्युक्त परिस्थिति में प्रयुक्त 'एकत्र' का पर्यायवाची शब्द क्या होगा?

Ans
- ✗ 1. वैभव
- ✗ 2. गायब
- ✓ 3. समवेत
- ✗ 4. जटिल

Q.3 निम्नलिखित में से 'पाशिका ' का तद्भव शब्द कौन-सा होगा-

Ans
- ✗ 1. फरुआ
- ✗ 2. फोड़ा
- ✓ 3. फाँसी
- ✗ 4. फुरती

Q.4 निम्नलिखित वाक्य में वर्तनी की दृष्टि से त्रुटिपूर्ण शब्द पहचानिए।
मुगलकालीन स्तापत्य उस युग के ऐश्वर्य और कलात्मकता का प्रमाण है।

Ans
- ✓ 1. स्तापत्य उस युग
- ✗ 2. मुगलकालीन
- ✗ 3. के ऐश्वर्य और
- ✗ 4. कलात्मकता का प्रमाण है।

Q.5 निम्नलिखित विकल्प में से तत्सम शब्द की पहचान कीजिए-

Ans
- ✗ 1. हल्दी
- ✗ 2. सब
- ✗ 3. हाथ
- ✓ 4. अनीश

Q.6 किसी सांस्कृतिक सम्मेलन में एक वक्ता ने कहा, "हमारे समाज की प्रगति समावेशन में है।" उसी चर्चा में विलोम दृष्टिकोण व्यक्त करना हो तो कौन-सा वाक्य उपयुक्त होगा?

Ans
- ✗ 1. समाज की प्रगति संरक्षण में निहित है।
- ✗ 2. समाज की प्रगति प्रतिस्पर्धा में निहित है।
- ✗ 3. समाज की प्रगति परिवर्तन में निहित है।
- ✓ 4. समाज की प्रगति बहिष्करण में निहित है।

Generated by rank.qmaths.in

Q.7 दिए गये वाक्य में रेखांकित शब्द का पर्यायवाची बताइए-
'श्री कृष्ण के भाई बलदेव जी हैं'

Ans
- ✗ 1. मारुति
- ✓ 2. बलभद्र
- ✗ 3. नारायण
- ✗ 4. पशुपति

Q.8 दिए गए वाक्य के किस भाग में त्रुटि है?
भारतीय वास्तुकला और दर्शन में 'धर्म' का अर्थ केवल पूजा-पद्धती नहीं, बल्कि 'सत्य और न्याय का धारण' है।

Ans
- ✗ 1. 'धर्म' का अर्थ केवल
- ✗ 2. 'सत्य और न्याय का धारण' है।
- ✗ 3. भारतीय वास्तुकला और दर्शन में
- ✓ 4. पूजा-पद्धती नहीं, बल्कि

Q.9 निम्न में से कौन-सा वाक्य विदेशज शब्द प्रयोग की दृष्टि से शुद्ध है?

Ans
- ✗ 1. बालक ने दीपक जलाकर अध्ययन शुरू कर दिया।
- ✗ 2. किसान ने समय पर बीज बोकर उचित निर्णय लिया।
- ✗ 3. विश्रामगृह पहुँचकर यात्रियों ने विश्राम किया।
- ✓ 4. बार-बार समझाने पर भी वह नामुराद अपनी आदतों से बाज़ नहीं आया।

Q.10 कवि ने अपने गीतों में कामदेव की छवि अत्यंत सुंदर ढंग से प्रस्तुत की है।
वाक्य में प्रयुक्त कामदेव शब्द का पर्यायवाची क्या है?

Ans
- ✗ 1. निकेतन
- ✗ 2. निष्ठुर
- ✓ 3. कंदर्प
- ✗ 4. परिणय

Q.11 सुमन को अपना घर अच्छा नहीं लगता है।
उपर्युक्त रेखांकित शब्द का विलोम क्या होगा?

Ans
- ✗ 1. निकट
- ✗ 2. अलग
- ✓ 3. पराया
- ✗ 4. वास्तविक

Q.12 निम्न में से कौन सा वाक्य विदेशज शब्द प्रयोग की दृष्टि से शुद्ध है?

Ans
- ✗ 1. माली ने उद्यान में पौधों की नियमित देखभाल की।
- ✓ 2. दुकान पर कूपन दिखाने पर उसे विशेष छूट मिल गई।
- ✗ 3. उसका जन्म शुभ नक्षत्र में हुआ।
- ✗ 4. विद्यार्थी प्रतिदिन पुस्तकालय में बैठकर अध्ययन करते हैं।

Q.13 नीचे दिए गए शब्दों में कौन सा शब्द तद्भव है ?

Ans
- ✗ 1. ताप
- ✗ 2. घृणा
- ✗ 3. द्रोण
- ✓ 4. लहसुन

Q.14 सही वर्तनी वाले वाक्य का चयन कीजिए —

Ans
- ✗ 1. सभी दस्तावेज संगीहीत कर लिए गए हैं।
- ✓ 2. सभी दस्तावेज संगृहीत कर लिए गए हैं।
- ✗ 3. सभी दस्तावेज संग्रहीत कर लिए गए हैं।
- ✗ 4. सभी दस्तावेज संगीहित कर लिए गए हैं।

Generated by rank.qmaths.in

Q.15 "पुराणों में इंद्राणी का वर्णन देवताओं की रानी के रूप में मिलता है।" उपर्युक्त वाक्य में प्रयुक्त 'इंद्राणी' का पर्यायवाची शब्द क्या होगा?

Ans
- ✗ 1. अमरावती
- ✗ 2. परमात्मा
- ✗ 3. कामना
- ✓ 4. जयवाहिनी

Comprehension:

निम्नलिखित गद्यांश का ध्यानपूर्वक अध्ययन कीजिए तथा उसके आधार पर दिए गए प्रश्नों के लिए सर्वाधिक उपयुक्त विकल्प का चयन कीजिए:
आधुनिक शिक्षा व्यवस्था में व्यावहारिक सक्षमता और औपचारिक प्रमाणपत्रों के मध्य की दूरी निरंतर बढ़ती जा रही है। वर्तमान शैक्षणिक ढाँचा विद्यार्थियों को वास्तविक ज्ञान, जीवनोपयोगी कौशल और व्यावहारिक दक्षता प्रदान करने के स्थान पर अंक-पत्रक तथा डिग्रियों की दौड़ में अधिक धकेल रहा है। परिणामस्वरूप, युवा वर्ग शिक्षा के वास्तविक उद्देश्य से दूर होकर मानसिक तनाव और चिंता से ग्रस्त होता जा रहा है। परीक्षा-केंद्रित शिक्षा मस्तिष्क की स्वतंत्र सोच,रचनात्मकता और मौलिक चिंतन को सीमित कर देती है। केवल डिग्रियाँ प्राप्त करने की प्रवृत्ति अंततः औसत दर्जे की मानसिकता को जन्म देती है। वर्तमान वैश्विक परिदृश्य में नियोक्ता कागजी प्रमाणपत्रों की अपेक्षा वास्तविक कौशल और कार्यकुशलता को अधिक महत्त्व देने लगे हैं। भविष्य में सफलता का आधार उपाधियाँ नहीं, बल्कि प्रतिभा, क्षमता और व्यावहारिक दक्षता होगी। शिक्षा का उद्देश्य दूसरों से प्रतिस्पर्धा करना या उनका अंधानुकरण करना नहीं,बल्कि अपनी मौलिक क्षमताओं की पहचान कर उनका विकास करना है। यदि मनुष्य की बौद्धिकता ही उसके मानसिक और शारीरिक स्वास्थ्य को प्रभावित करने लगे, तो डिग्रियों का महत्त्व कम हो जाता है। योग आंतरिक संतुलन और आत्मविकास का प्रभावी माध्यम है। जीवन कोई निश्चित लक्ष्य नहीं,बल्कि सतत चलने वाली विकास-यात्रा है। अतः युवाओं को तुलना और अनावश्यक प्रतिस्पर्धा से दूर रहकर साहस, संतुलन, सुदृढ़ इच्छाशक्ति तथा आत्मविश्वास के आधार पर अपनी वास्तविक क्षमता का विकास करना चाहिए।

SubQuestion No : 16

Q.16 गद्यांश के लिए सर्वाधिक उपयुक्त शीर्षक चुनिए:

Ans
- ✗ 1. योग और स्वास्थ्य
- ✗ 2. वैश्विक रोजगार
- ✗ 3. परीक्षामुखी व्यवस्था
- ✓ 4. कौशलपरक शिक्षा

Comprehension:

निम्नलिखित गद्यांश का ध्यानपूर्वक अध्ययन कीजिए तथा उसके आधार पर दिए गए प्रश्नों के लिए सर्वाधिक उपयुक्त विकल्प का चयन कीजिए:
आधुनिक शिक्षा व्यवस्था में व्यावहारिक सक्षमता और औपचारिक प्रमाणपत्रों के मध्य की दूरी निरंतर बढ़ती जा रही है। वर्तमान शैक्षणिक ढाँचा विद्यार्थियों को वास्तविक ज्ञान, जीवनोपयोगी कौशल और व्यावहारिक दक्षता प्रदान करने के स्थान पर अंक-पत्रक तथा डिग्रियों की दौड़ में अधिक धकेल रहा है। परिणामस्वरूप, युवा वर्ग शिक्षा के वास्तविक उद्देश्य से दूर होकर मानसिक तनाव और चिंता से ग्रस्त होता जा रहा है। परीक्षा-केंद्रित शिक्षा मस्तिष्क की स्वतंत्र सोच,रचनात्मकता और मौलिक चिंतन को सीमित कर देती है। केवल डिग्रियाँ प्राप्त करने की प्रवृत्ति अंततः औसत दर्जे की मानसिकता को जन्म देती है। वर्तमान वैश्विक परिदृश्य में नियोक्ता कागजी प्रमाणपत्रों की अपेक्षा वास्तविक कौशल और कार्यकुशलता को अधिक महत्त्व देने लगे हैं। भविष्य में सफलता का आधार उपाधियाँ नहीं, बल्कि प्रतिभा, क्षमता और व्यावहारिक दक्षता होगी। शिक्षा का उद्देश्य दूसरों से प्रतिस्पर्धा करना या उनका अंधानुकरण करना नहीं,बल्कि अपनी मौलिक क्षमताओं की पहचान कर उनका विकास करना है। यदि मनुष्य की बौद्धिकता ही उसके मानसिक और शारीरिक स्वास्थ्य को प्रभावित करने लगे, तो डिग्रियों का महत्त्व कम हो जाता है। योग आंतरिक संतुलन और आत्मविकास का प्रभावी माध्यम है। जीवन कोई निश्चित लक्ष्य नहीं,बल्कि सतत चलने वाली विकास-यात्रा है। अतः युवाओं को तुलना और अनावश्यक प्रतिस्पर्धा से दूर रहकर साहस, संतुलन, सुदृढ़ इच्छाशक्ति तथा आत्मविश्वास के आधार पर अपनी वास्तविक क्षमता का विकास करना चाहिए।

SubQuestion No : 17

Q.17 निम्नलिखित गद्यांश की प्रमुख संरचना क्या है?

Ans
- ✓ 1. समस्या और समाधान
- ✗ 2. तुलनात्मक
- ✗ 3. कालक्रमानुसार
- ✗ 4. कारण और परिणाम

Comprehension:

निम्नलिखित गद्यांश का ध्यानपूर्वक अध्ययन कीजिए तथा उसके आधार पर दिए गए प्रश्नों के लिए सर्वाधिक उपयुक्त विकल्प का चयन कीजिए:
आधुनिक शिक्षा व्यवस्था में व्यावहारिक सक्षमता और औपचारिक प्रमाणपत्रों के मध्य की दूरी निरंतर बढ़ती जा रही है। वर्तमान शैक्षणिक ढाँचा विद्यार्थियों को वास्तविक ज्ञान, जीवनोपयोगी कौशल और व्यावहारिक दक्षता प्रदान करने के स्थान पर अंक-पत्रक तथा डिग्रियों की दौड़ में अधिक धकेल रहा है। परिणामस्वरूप, युवा वर्ग शिक्षा के वास्तविक उद्देश्य से दूर होकर मानसिक तनाव और चिंता से ग्रस्त होता जा रहा है। परीक्षा-केंद्रित शिक्षा मस्तिष्क की स्वतंत्र सोच,रचनात्मकता और मौलिक चिंतन को सीमित कर देती है। केवल डिग्रियाँ प्राप्त करने की प्रवृत्ति अंततः औसत दर्जे की मानसिकता को जन्म देती है। वर्तमान वैश्विक परिदृश्य में नियोक्ता कागजी प्रमाणपत्रों की अपेक्षा वास्तविक कौशल और कार्यकुशलता को अधिक महत्त्व देने लगे हैं। भविष्य में सफलता का आधार उपाधियाँ नहीं, बल्कि प्रतिभा, क्षमता और व्यावहारिक दक्षता होगी। शिक्षा का उद्देश्य दूसरों से प्रतिस्पर्धा करना या उनका अंधानुकरण करना नहीं,बल्कि अपनी मौलिक क्षमताओं की पहचान कर उनका विकास करना है। यदि मनुष्य की बौद्धिकता ही उसके मानसिक और शारीरिक स्वास्थ्य को प्रभावित करने लगे, तो डिग्रियों का महत्त्व कम हो जाता है। योग आंतरिक संतुलन और आत्मविकास का प्रभावी माध्यम है। जीवन कोई निश्चित लक्ष्य नहीं,बल्कि सतत चलने वाली विकास-यात्रा है। अतः युवाओं को तुलना और अनावश्यक प्रतिस्पर्धा से दूर रहकर साहस, संतुलन, सुदृढ़ इच्छाशक्ति तथा आत्मविश्वास के आधार पर अपनी वास्तविक क्षमता का विकास करना चाहिए।

SubQuestion No : 18

Q.18 गद्यांश का मुख्य विषय क्या है?

Ans
- ✓ 1. शिक्षा का उद्देश्य कौशल, आत्मविकास और संतुलित जीवन-दृष्टि का निर्माण।
- ✗ 2. मानसिक स्वास्थ्य, योगाभ्यास और शारीरिक व्यायाम की उपयोगिता का विवेचन।
- ✗ 3. प्रतियोगी परीक्षाओं की तैयारी, रोजगार और आर्थिक सफलता का महत्त्व।
- ✗ 4. आधुनिक तकनीक, वैश्वीकरण और औद्योगिक विकास के प्रभावों का विश्लेषण।

Generated by rank.qmaths.in

Comprehension:

निम्नलिखित गद्यांश का ध्यानपूर्वक अध्ययन कीजिए तथा उसके आधार पर दिए गए प्रश्नों के लिए सर्वाधिक उपयुक्त विकल्प का चयन कीजिए:
आधुनिक शिक्षा व्यवस्था में व्यावहारिक सक्षमता और औपचारिक प्रमाणपत्रों के मध्य की दूरी निरंतर बढ़ती जा रही है। वर्तमान शैक्षणिक ढाँचा विद्यार्थियों को वास्तविक ज्ञान, जीवनोपयोगी कौशल और व्यावहारिक दक्षता प्रदान करने के स्थान पर अंक-पत्रक तथा डिग्रियों की दौड़ में अधिक धकेल रहा है। परिणामस्वरूप, युवा वर्ग शिक्षा के वास्तविक उद्देश्य से दूर होकर मानसिक तनाव और चिंता से ग्रस्त होता जा रहा है। परीक्षा-केंद्रित शिक्षा मस्तिष्क की स्वतंत्र सोच,रचनात्मकता और मौलिक चिंतन को सीमित कर देती है। केवल डिग्रियाँ प्राप्त करने की प्रवृत्ति अंततः औसत दर्जे की मानसिकता को जन्म देती है। वर्तमान वैश्विक परिदृश्य में नियोक्ता कागजी प्रमाणपत्रों की अपेक्षा वास्तविक कौशल और कार्यकुशलता को अधिक महत्त्व देने लगे हैं। भविष्य में सफलता का आधार उपाधियाँ नहीं, बल्कि प्रतिभा, क्षमता और व्यावहारिक दक्षता होगी। शिक्षा का उद्देश्य दूसरों से प्रतिस्पर्धा करना या उनका अंधानुकरण करना नहीं,बल्कि अपनी मौलिक क्षमताओं की पहचान कर उनका विकास करना है। यदि मनुष्य की बौद्धिकता ही उसके मानसिक और शारीरिक स्वास्थ्य को प्रभावित करने लगे, तो डिग्रियों का महत्त्व कम हो जाता है। योग आंतरिक संतुलन और आत्मविकास का प्रभावी माध्यम है। जीवन कोई निश्चित लक्ष्य नहीं,बल्कि सतत चलने वाली विकास-यात्रा है। अतः युवाओं को तुलना और अनावश्यक प्रतिस्पर्धा से दूर रहकर साहस, संतुलन, सुदृढ़ इच्छाशक्ति तथा आत्मविश्वास के आधार पर अपनी वास्तविक क्षमता का विकास करना चाहिए।

SubQuestion No : 19

Q.19 गद्यांश का सर्वाधिक उपयुक्त निष्कर्ष क्या है?

Ans
- ✗ 1. उच्च शिक्षा प्राप्त करने के लिए अधिक अंक और प्रमाणपत्र अनिवार्य साधन हैं।
- ✗ 2. मानसिक स्वास्थ्य की सभी समस्याओं का समाधान केवल योगाभ्यास से संभव है।
- ✗ 3. वैश्विक प्रतिस्पर्धा में सफलता के लिए दूसरों का अनुकरण करना आवश्यक है।
- ✓ 4. वास्तविक सफलता डिग्रियों से अधिक कौशल, आत्मविश्वास और संतुलित दृष्टि पर आधारित होती है।

Comprehension:

निम्नलिखित गद्यांश का ध्यानपूर्वक अध्ययन कीजिए तथा उसके आधार पर दिए गए प्रश्नों के लिए सर्वाधिक उपयुक्त विकल्प का चयन कीजिए:
आधुनिक शिक्षा व्यवस्था में व्यावहारिक सक्षमता और औपचारिक प्रमाणपत्रों के मध्य की दूरी निरंतर बढ़ती जा रही है। वर्तमान शैक्षणिक ढाँचा विद्यार्थियों को वास्तविक ज्ञान, जीवनोपयोगी कौशल और व्यावहारिक दक्षता प्रदान करने के स्थान पर अंक-पत्रक तथा डिग्रियों की दौड़ में अधिक धकेल रहा है। परिणामस्वरूप, युवा वर्ग शिक्षा के वास्तविक उद्देश्य से दूर होकर मानसिक तनाव और चिंता से ग्रस्त होता जा रहा है। परीक्षा-केंद्रित शिक्षा मस्तिष्क की स्वतंत्र सोच,रचनात्मकता और मौलिक चिंतन को सीमित कर देती है। केवल डिग्रियाँ प्राप्त करने की प्रवृत्ति अंततः औसत दर्जे की मानसिकता को जन्म देती है। वर्तमान वैश्विक परिदृश्य में नियोक्ता कागजी प्रमाणपत्रों की अपेक्षा वास्तविक कौशल और कार्यकुशलता को अधिक महत्त्व देने लगे हैं। भविष्य में सफलता का आधार उपाधियाँ नहीं, बल्कि प्रतिभा, क्षमता और व्यावहारिक दक्षता होगी। शिक्षा का उद्देश्य दूसरों से प्रतिस्पर्धा करना या उनका अंधानुकरण करना नहीं,बल्कि अपनी मौलिक क्षमताओं की पहचान कर उनका विकास करना है। यदि मनुष्य की बौद्धिकता ही उसके मानसिक और शारीरिक स्वास्थ्य को प्रभावित करने लगे, तो डिग्रियों का महत्त्व कम हो जाता है। योग आंतरिक संतुलन और आत्मविकास का प्रभावी माध्यम है। जीवन कोई निश्चित लक्ष्य नहीं,बल्कि सतत चलने वाली विकास-यात्रा है। अतः युवाओं को तुलना और अनावश्यक प्रतिस्पर्धा से दूर रहकर साहस, संतुलन, सुदृढ़ इच्छाशक्ति तथा आत्मविश्वास के आधार पर अपनी वास्तविक क्षमता का विकास करना चाहिए।

SubQuestion No : 20

Q.20 गद्यांश में प्रयुक्त 'सुदृढ़' शब्द का विलोम चुनिए-

Ans
- ✓ 1. दुर्बल
- ✗ 2. अविकसित
- ✗ 3. अशक्त
- ✗ 4. अस्थिर

Section : **English Language and Comprehension**

Q.1 Choose the correct option that substitutes the underlined phrase in the given sentence.
Before take-off, the pilot checked a/an <u>instrument that measures the altitude of an aircraft above a reference level</u>.

Ans
- ✓ 1. altimeter
- ✗ 2. hygrometer
- ✗ 3. anemometer
- ✗ 4. barometer

Q.2 Identify the error in one of the segments in bold letters in the sentence:
The political strategist noted that the candidate's speech was highly effective, but her un-advised comments during the press conference caused a significant drop in the latest polling numbers widespread public criticism.

Ans
- ✗ 1. a significant drop
- ✗ 2. highly effective
- ✗ 3. widespread public
- ✓ 4. un-advised comments

Generated by rank.qmaths.in

Q.3 **In the following sentences, identify the part of the sentence that contains an error related to the usage of adverbs. Choose the option that indicates the error.**
The artist's new painting was exceptionally beautiful, capturing the attention of critics and collectors alike. She had worked diligent on every detail, ensuring that the composition was precisely balanced. As a result, her latest masterpiece was widely admired in the art community.

Ans
- ✗ 1. precisely balanced
- ✗ 2. widely admired
- ✓ 3. diligent
- ✗ 4. exceptionally beautiful

Q.4 **In the given question, a statement is divided into segments. Rearrange all the segments to form a coherent sentence. Choose the option that shows the correct order.**

(A) of the Earth's tectonic restlessness / (B) epitomize the fragility of human / (C) earthquakes, as abrupt manifestations / (D) infrastructure when confronted with / (E) the relentless dynamism of natural forces

Ans
- ✗ 1. DEABC
- ✓ 2. CABDE
- ✗ 3. EBCAD
- ✗ 4. ABCDE

Q.5 **Identify the part of the sentence that contains the error.**
The software update provides more faster processing for large datasets generated by research laboratories utilizing sophisticated parallel computing architectures.

Ans
- ✗ 1. utilizing sophisticated
- ✓ 2. more faster processing
- ✗ 3. generated by research
- ✗ 4. parallel computing architectures

Q.6 **Select the most appropriate meaning of the given proverb.**

Two heads are better than one.

Ans
- ✗ 1. One person's opinion is not valuable.
- ✗ 2. Two people should always think alike.
- ✓ 3. Collaboration leads to better solutions.
- ✗ 4. Having two members is always beneficial.

Q.7 **A group of words has been underlined in the sentence given below. Choose the correct word segment to substitute the underlined section of the sentence.**
The committee was applauded for <u>their decision to give up power voluntarily for the greater good</u>.

Ans
- ✗ 1. Abrogation
- ✗ 2. Resignation
- ✗ 3. Renunciation
- ✓ 4. Abdication

Q.8 **Choose the correct one-word substitute for the following expression.**
A person who deserts military service without permission.

Ans
- ✗ 1. Veteran
- ✗ 2. Stoic
- ✗ 3. Mercenary
- ✓ 4. Deserter

Generated by rank.qmaths.in

Q.9 **A sentence has been divided into four parts. Identify the part that contains a grammatical error.**
The mountain expedition / proved far difficult / than the team / had initially expected.

Ans
- ✗ 1. The mountain expedition
- ✗ 2. than the team
- ✓ 3. proved far difficult
- ✗ 4. had initially expected.

Q.10 **Select the most appropriate SYNONYM of the highlighted word in the given sentence.**

The judge gave a <u>succinct</u> summary of the case before delivering the verdict.

Ans
- ✗ 1. decorative
- ✗ 2. elaborate
- ✓ 3. concise
- ✗ 4. dismissive

Q.11 **Choose the correct option that substitutes the underlined phrase in the given sentence.**
She avoids climbing observation towers because she has <u>an irrational fear of heights</u>.

Ans
- ✓ 1. acrophobia
- ✗ 2. mysophobia
- ✗ 3. claustrophobia
- ✗ 4. aviophobia

Q.12 **Choose the segment with an error:**
Despite the orchestra's / meticulous rehearsals, the / performance sounded much harmonious / than any concert held by the /renowned groups in the last decade.

Ans
- ✗ 1. Despite the orchestra's
- ✗ 2. meticulous rehearsals, the
- ✓ 3. performance sounded much harmonious
- ✗ 4. renowned groups in the last decade.

Q.13 **In the given question, a statement divided into different segments is given. The first segment is fixed. Rearrange the remaining segments to form a coherent sentence.**
(A) after the district monitoring authority compared bridge inspection planning application registers with beneficiary follow-up data during the quarterly review
(B) committee members identified data omissions affecting bridge inspection planning decisions across multiple review files
(C) for that reason administrators revised licensing conditions for bridge inspection planning before the next reporting period opened under formal oversight
(D) this evidence showed that the bridge inspection planning problem resulted from unreconciled field data rather than seasonal demand variation

Ans
- ✗ 1. ADBC
- ✗ 2. ACDB
- ✗ 3. ADCB
- ✓ 4. ABDC

Q.14 **Which sentence contains a subtle error in adjective use that alters the meaning of the statement?**

Ans
- ✗ 1. The council approved several policies more ambitious than those adopted last year.
- ✗ 2. The council approved several policies that are more ambitious than last year's.
- ✓ 3. The council approved several innovative policies ambitious than those adopted last year.
- ✗ 4. The council approved several more ambitious policies than those adopted last year.

Generated by rank.qmaths.in

Q.15 Choose the correct one-word substitute for the following expression.
A person who predicts future events by claimed supernatural means.

Ans
✗ 1. Mystic
✓ 2. Oracle
✗ 3. Medium
✗ 4. Clairvoyant

Comprehension:

Read the passage carefully and choose the correct option to fill in the blanks.

Digital literacy has become an essential competence in modern society, enabling individuals to access information, evaluate online sources, and communicate effectively across digital platforms. Educational institutions increasingly integrate technology into teaching to (1) _____ students with the skills required for academic and professional success. However, the rapid spread of misinformation can (2) _____ public understanding of important social and scientific issues. Therefore, learners should (3) _____ information by examining its credibility, relevance, and authenticity before accepting it as factual. Educational programmes that emphasize critical thinking and responsible online behaviour help (4) _____ informed digital citizens capable of making sound judgments. As technology continues to evolve, individuals must (5) _____ ethical principles while interacting in digital environments.

SubQuestion No : 16

Q.16 Choose the correct option to fill in blank 1.

Ans
✗ 1. distribute
✓ 2. equip
✗ 3. transfer
✗ 4. assign

Comprehension:

Read the passage carefully and choose the correct option to fill in the blanks.

Digital literacy has become an essential competence in modern society, enabling individuals to access information, evaluate online sources, and communicate effectively across digital platforms. Educational institutions increasingly integrate technology into teaching to (1) _____ students with the skills required for academic and professional success. However, the rapid spread of misinformation can (2) _____ public understanding of important social and scientific issues. Therefore, learners should (3) _____ information by examining its credibility, relevance, and authenticity before accepting it as factual. Educational programmes that emphasize critical thinking and responsible online behaviour help (4) _____ informed digital citizens capable of making sound judgments. As technology continues to evolve, individuals must (5) _____ ethical principles while interacting in digital environments.

SubQuestion No : 17

Q.17 Choose the correct option to fill in blank 2.

Ans
✗ 1. organize
✗ 2. preserve
✗ 3. assemble
✓ 4. distort

Comprehension:

Read the passage carefully and choose the correct option to fill in the blanks.

Digital literacy has become an essential competence in modern society, enabling individuals to access information, evaluate online sources, and communicate effectively across digital platforms. Educational institutions increasingly integrate technology into teaching to (1) _____ students with the skills required for academic and professional success. However, the rapid spread of misinformation can (2) _____ public understanding of important social and scientific issues. Therefore, learners should (3) _____ information by examining its credibility, relevance, and authenticity before accepting it as factual. Educational programmes that emphasize critical thinking and responsible online behaviour help (4) _____ informed digital citizens capable of making sound judgments. As technology continues to evolve, individuals must (5) _____ ethical principles while interacting in digital environments.

SubQuestion No : 18

Q.18 Choose the correct option to fill in blank 3.

Ans
✓ 1. evaluate
✗ 2. compile
✗ 3. transmit
✗ 4. circulate

Generated by rank.qmaths.in

Comprehension:

Read the passage carefully and choose the correct option to fill in the blanks.

Digital literacy has become an essential competence in modern society, enabling individuals to access information, evaluate online sources, and communicate effectively across digital platforms. Educational institutions increasingly integrate technology into teaching to (1) _____ students with the skills required for academic and professional success. However, the rapid spread of misinformation can (2) _____ public understanding of important social and scientific issues. Therefore, learners should (3) _____ information by examining its credibility, relevance, and authenticity before accepting it as factual. Educational programmes that emphasize critical thinking and responsible online behaviour help (4) _____ informed digital citizens capable of making sound judgments. As technology continues to evolve, individuals must (5) _____ ethical principles while interacting in digital environments.

SubQuestion No : 19

Q.19 Choose the correct option to fill in blank 4.

Ans

✗ 1. modify

✗ 2. reorganize

✗ 3. designate

✓ 4. cultivate

Comprehension:

Read the passage carefully and choose the correct option to fill in the blanks.

Digital literacy has become an essential competence in modern society, enabling individuals to access information, evaluate online sources, and communicate effectively across digital platforms. Educational institutions increasingly integrate technology into teaching to (1) _____ students with the skills required for academic and professional success. However, the rapid spread of misinformation can (2) _____ public understanding of important social and scientific issues. Therefore, learners should (3) _____ information by examining its credibility, relevance, and authenticity before accepting it as factual. Educational programmes that emphasize critical thinking and responsible online behaviour help (4) _____ informed digital citizens capable of making sound judgments. As technology continues to evolve, individuals must (5) _____ ethical principles while interacting in digital environments.

SubQuestion No : 20

Q.20 Choose the correct option to fill in blank 5.

Ans

✗ 1. inspect

✓ 2. uphold

✗ 3. revise

✗ 4. classify

Section : **English Language and Comprehension 2**

Q.1 Choose the option which uses the correct form of the active voice for the given sentence. Conflicting data points in the thesis were systematically resolved by the graduate student.

Ans

✓ 1. The graduate student systematically resolved conflicting data points in the thesis.

✗ 2. The graduate student systematically resolves conflicting data points in the thesis.

✗ 3. The graduate student was systematically resolving conflicting data points in the thesis.

✗ 4. The graduate student has systematically resolved conflicting data points in the thesis.

Q.2 What does this phrase "Even a worm will turn" mean?

Ans

✗ 1. Weak people are always powerless.

✗ 2. The smallest creatures have the biggest influence.

✗ 3. Success comes from patience and endurance.

✓ 4. Even the weakest will retaliate when pushed too far.

Q.3 **Select the most appropriate word from the options given, which replaces the underlined word in the sentence:**
Even though Vandana's standards seem <u>stringent</u>, they help her disciples achieve remarkable discipline.

Ans
✗ 1. springy
✗ 2. bendable
✓ 3. adamant
✗ 4. drooping

Q.4 **Choose the correct passive form of the given sentence.**

While the negotiators were finalising the communiqué, protesters were surrounding the conference hall on every side.

Ans
✗ 1. While the negotiators were finalising the communiqué, the conference hall was surrounding by protesters on every side.
✗ 2. While the negotiators were finalising the communiqué, the conference hall was surrounded by protesters on every side.
✗ 3. While the negotiators were finalising the communiqué, the conference hall had been surrounded by protesters on every side.
✓ 4. While the negotiators were finalising the communiqué, the conference hall was being surrounded by protesters on every side.

Q.5 **Despite repeated assurances, the politician failed to keep his promise, and eventually, his actions were revealed as nothing more than a series of empty declarations.**

Choose the best idiom to replace 'a series of empty declarations.'

Ans
✗ 1. a blessing in disguise
✗ 2. the tip of the iceberg
✓ 3. a flash in the pan
✗ 4. a drop in the ocean

Q.6 **Find the error in the following sentence.**
She seen the movie last night before we discussed it during our class discussion today.

Ans
✗ 1. before we discussed it
✗ 2. last night
✗ 3. during our class discussion today
✓ 4. She seen the movie

Q.7 **Choose the option that is the closest in meaning to the highlighted word in the sentence.**
The crime scene, which had seemed horrifying in the description, appeared even more gruesome when witnessed in person.

Ans
✗ 1. tranquil
✓ 2. macabre
✗ 3. mundane
✗ 4. ordinary

Q.8 **Choose the sentence that correctly uses the Future Perfect Tense.**

Ans
✗ 1. By next summer, the construction team will complete the new bridge, allowing traffic to flow across the river for the first time in years.
✗ 2. By next summer, the construction team will be completing the new bridge, allowing traffic to flow across the river for the first time in years.
✗ 3. By next summer, the construction team had completed the new bridge, allowing traffic to flow across the river for the first time in years.
✓ 4. By next summer, the construction team will have completed the new bridge, allowing traffic to flow across the river for the first time in years.

Generated by rank.qmaths.in

Q.9 **Select the option that expresses the given sentence in reported speech.**

She said to her assistant, "Have you submitted all the reports that were due last week?"

Ans

✗ 1. She asked her assistant had he submitted all the reports which were due the previous week.

✗ 2. She asked her assistant if he has submitted all the reports that were due previous week.

✗ 3. She inquired her assistant whether he submitted all the reports due last week.

✓ 4. She asked her assistant whether he had submitted all the reports that had been due the previous week.

Q.10 **Read the following sentence and convert it into indirect speech.**

She said, "If I had known the truth, I would have acted differently."

Ans

✗ 1. She said that if she knows the truth, she would act differently.

✓ 2. She said that if she had known the truth, she would have acted differently.

✗ 3. She said if she knew the truth, she would have acted differently.

✗ 4. She said if she had known the truth, she will have acted differently.

Comprehension:

Read the given passage carefully and choose the correct answers to the questions based on it.

Acupuncture is a therapeutic practice that originated in traditional Chinese medicine more than two thousand years ago. It involves the insertion of extremely fine needles into specific points on the body with the aim of promoting physiological balance and alleviating various health conditions. Traditionally, acupuncture is based on the concept that vital energy, often referred to as Qi, flows through pathways known as meridians. Contemporary medical researchers, however, have explored acupuncture from a biomedical perspective, suggesting that the treatment may stimulate nerves, muscles, and connective tissues, thereby influencing pain perception and certain physiological responses. Although the precise mechanisms remain the subject of ongoing investigation, acupuncture has gained recognition as a complementary therapy for managing chronic pain, migraines, and some musculoskeletal disorders.

Despite its growing acceptance, opinions regarding acupuncture continue to differ among healthcare professionals. Some researchers emphasise encouraging clinical evidence supporting its effectiveness for particular conditions, whereas others argue that additional high-quality studies are required before broader conclusions can be drawn. Consequently, many medical practitioners recommend acupuncture as a complementary treatment rather than a replacement for evidence-based conventional medicine. Proper training, sterile techniques, and informed clinical practice remain essential to ensure patient safety and minimise potential complications.

The increasing integration of acupuncture into modern healthcare illustrates the broader movement toward combining traditional healing practices with scientific evaluation. Its continued acceptance will likely depend upon rigorous research, informed patient choice, and constructive dialogue between traditional knowledge systems and contemporary medical science.

SubQuestion No : 11

Q.11 **Which of the following best establishes a text-to-world connection with the passage?**

Ans

✗ 1. Many governments and public agencies now promote digital services alongside conventional administrative procedures.

✗ 2. Many universities and research institutions now expand interdisciplinary programmes alongside traditional academic disciplines.

✗ 3. Many industries and manufacturing firms now adopt automated technologies alongside established production methods.

✓ 4. Many hospitals and healthcare centres now incorporate complementary therapies alongside conventional medical treatments.

Generated by rank.qmaths.in

Comprehension:

Read the given passage carefully and choose the correct answers to the questions based on it.

Acupuncture is a therapeutic practice that originated in traditional Chinese medicine more than two thousand years ago. It involves the insertion of extremely fine needles into specific points on the body with the aim of promoting physiological balance and alleviating various health conditions. Traditionally, acupuncture is based on the concept that vital energy, often referred to as Qi, flows through pathways known as meridians. Contemporary medical researchers, however, have explored acupuncture from a biomedical perspective, suggesting that the treatment may stimulate nerves, muscles, and connective tissues, thereby influencing pain perception and certain physiological responses. Although the precise mechanisms remain the subject of ongoing investigation, acupuncture has gained recognition as a complementary therapy for managing chronic pain, migraines, and some musculoskeletal disorders.

Despite its growing acceptance, opinions regarding acupuncture continue to differ among healthcare professionals. Some researchers emphasise encouraging clinical evidence supporting its effectiveness for particular conditions, whereas others argue that additional high-quality studies are required before broader conclusions can be drawn. Consequently, many medical practitioners recommend acupuncture as a complementary treatment rather than a replacement for evidence-based conventional medicine. Proper training, sterile techniques, and informed clinical practice remain essential to ensure patient safety and minimise potential complications.

The increasing integration of acupuncture into modern healthcare illustrates the broader movement toward combining traditional healing practices with scientific evaluation. Its continued acceptance will likely depend upon rigorous research, informed patient choice, and constructive dialogue between traditional knowledge systems and contemporary medical science.

SubQuestion No : 12

Q.12 Which of the following best summarizes the passage?

Ans

✗ 1. Acupuncture is a traditional therapeutic practice that should replace conventional medical treatments because of its proven effectiveness in treating every health condition.

✓ 2. Acupuncture is an ancient therapeutic practice that has gained recognition in modern healthcare, although its broader acceptance depends on scientific evidence, safe practice, and continued research.

✗ 3. Acupuncture is a historical cultural practice whose significance lies primarily in preserving traditional customs rather than supporting modern healthcare systems.

✗ 4. Acupuncture is an alternative therapeutic practice whose future depends mainly on technological innovation instead of scientific evaluation and clinical evidence.

Comprehension:

Read the given passage carefully and choose the correct answers to the questions based on it.

Acupuncture is a therapeutic practice that originated in traditional Chinese medicine more than two thousand years ago. It involves the insertion of extremely fine needles into specific points on the body with the aim of promoting physiological balance and alleviating various health conditions. Traditionally, acupuncture is based on the concept that vital energy, often referred to as Qi, flows through pathways known as meridians. Contemporary medical researchers, however, have explored acupuncture from a biomedical perspective, suggesting that the treatment may stimulate nerves, muscles, and connective tissues, thereby influencing pain perception and certain physiological responses. Although the precise mechanisms remain the subject of ongoing investigation, acupuncture has gained recognition as a complementary therapy for managing chronic pain, migraines, and some musculoskeletal disorders.

Despite its growing acceptance, opinions regarding acupuncture continue to differ among healthcare professionals. Some researchers emphasise encouraging clinical evidence supporting its effectiveness for particular conditions, whereas others argue that additional high-quality studies are required before broader conclusions can be drawn. Consequently, many medical practitioners recommend acupuncture as a complementary treatment rather than a replacement for evidence-based conventional medicine. Proper training, sterile techniques, and informed clinical practice remain essential to ensure patient safety and minimise potential complications.

The increasing integration of acupuncture into modern healthcare illustrates the broader movement toward combining traditional healing practices with scientific evaluation. Its continued acceptance will likely depend upon rigorous research, informed patient choice, and constructive dialogue between traditional knowledge systems and contemporary medical science.

SubQuestion No : 13

Q.13 Which word best describes the overall tone of the passage?

Ans

✗ 1. Skeptical

✓ 2. Objective

✗ 3. Enthusiastic

✗ 4. Humorous

Comprehension:

Read the given passage carefully and choose the correct answers to the questions based on it.

Acupuncture is a therapeutic practice that originated in traditional Chinese medicine more than two thousand years ago. It involves the insertion of extremely fine needles into specific points on the body with the aim of promoting physiological balance and alleviating various health conditions. Traditionally, acupuncture is based on the concept that vital energy, often referred to as Qi, flows through pathways known as meridians. Contemporary medical researchers, however, have explored acupuncture from a biomedical perspective, suggesting that the treatment may stimulate nerves, muscles, and connective tissues, thereby influencing pain perception and certain physiological responses. Although the precise mechanisms remain the subject of ongoing investigation, acupuncture has gained recognition as a complementary therapy for managing chronic pain, migraines, and some musculoskeletal disorders.

Despite its growing acceptance, opinions regarding acupuncture continue to differ among healthcare professionals. Some researchers emphasise encouraging clinical evidence supporting its effectiveness for particular conditions, whereas others argue that additional high-quality studies are required before broader conclusions can be drawn. Consequently, many medical practitioners recommend acupuncture as a complementary treatment rather than a replacement for evidence-based conventional medicine. Proper training, sterile techniques, and informed clinical practice remain essential to ensure patient safety and minimise potential complications.

The increasing integration of acupuncture into modern healthcare illustrates the broader movement toward combining traditional healing practices with scientific evaluation. Its continued acceptance will likely depend upon rigorous research, informed patient choice, and constructive dialogue between traditional knowledge systems and contemporary medical science.

SubQuestion No : 14

Q.14 According to the passage, why do many medical practitioners recommend acupuncture as a complementary treatment?

Ans

✗ 1. Because available evidence confirms that it provides permanent relief for nearly all chronic medical conditions

✗ 2. Because clinical experience demonstrates that it consistently outperforms conventional medicine in every therapeutic context

✓ 3. Because additional research is still required before it can replace conventional medicine

✗ 4. Because advances in alternative medicine have rendered conventional medical practices largely unnecessary in modern healthcare

Comprehension:

Read the given passage carefully and choose the correct answers to the questions based on it.

Acupuncture is a therapeutic practice that originated in traditional Chinese medicine more than two thousand years ago. It involves the insertion of extremely fine needles into specific points on the body with the aim of promoting physiological balance and alleviating various health conditions. Traditionally, acupuncture is based on the concept that vital energy, often referred to as Qi, flows through pathways known as meridians. Contemporary medical researchers, however, have explored acupuncture from a biomedical perspective, suggesting that the treatment may stimulate nerves, muscles, and connective tissues, thereby influencing pain perception and certain physiological responses. Although the precise mechanisms remain the subject of ongoing investigation, acupuncture has gained recognition as a complementary therapy for managing chronic pain, migraines, and some musculoskeletal disorders.

Despite its growing acceptance, opinions regarding acupuncture continue to differ among healthcare professionals. Some researchers emphasise encouraging clinical evidence supporting its effectiveness for particular conditions, whereas others argue that additional high-quality studies are required before broader conclusions can be drawn. Consequently, many medical practitioners recommend acupuncture as a complementary treatment rather than a replacement for evidence-based conventional medicine. Proper training, sterile techniques, and informed clinical practice remain essential to ensure patient safety and minimise potential complications.

The increasing integration of acupuncture into modern healthcare illustrates the broader movement toward combining traditional healing practices with scientific evaluation. Its continued acceptance will likely depend upon rigorous research, informed patient choice, and constructive dialogue between traditional knowledge systems and contemporary medical science.

SubQuestion No : 15

Q.15 Which inference can reasonably be drawn from the passage?

Ans

✗ 1. Future development of acupuncture will depend primarily on replacing conventional medicine with alternative therapeutic practices.

✗ 2. Future implementation of acupuncture will depend largely on expanding its use without professional standards.

✓ 3. Future acceptance of acupuncture will depend on continued collaboration between traditional medical knowledge and scientific research.

✗ 4. Future evaluation of acupuncture will depend mainly on preserving traditional beliefs without further scientific investigation.

Generated by rank.qmaths.in

Comprehension:

Read the given passage carefully and choose the correct answers to the questions based on it.

Virtual reality (VR) games have transformed digital entertainment by creating immersive environments that allow players to interact with computer-generated worlds in real time. Unlike conventional video games played on flat screens, VR experiences employ head-mounted displays, motion sensors, and handheld controllers to simulate physical presence within a virtual environment. This heightened sense of immersion has expanded the application of VR beyond recreation, influencing education, healthcare, military training, and professional skill development. Consequently, virtual reality is increasingly viewed not merely as a gaming technology but as a versatile platform for experiential learning and simulation.

Despite its growing popularity, virtual reality gaming presents several challenges. Extended use may contribute to motion sickness, eye strain, or physical discomfort for some users. Moreover, concerns have emerged regarding excessive screen time, psychological dependence, and the potential effects of highly immersive environments on social interaction. Researchers therefore argue that responsible usage, combined with ergonomic design and informed user practices, is essential to maximise benefits while minimising potential risks.

The rapid evolution of virtual reality games reflects broader technological advances in artificial intelligence, graphics processing, and human-computer interaction. As hardware becomes more affordable and software increasingly sophisticated, VR is expected to become more accessible across diverse sectors. Nevertheless, its long-term success will depend on balancing technological innovation with ethical considerations, user safety, and meaningful applications. Ultimately, virtual reality games illustrate how emerging technologies can simultaneously entertain, educate, and reshape the ways in which individuals interact with digital environments.

SubQuestion No : 16

Q.16 Which of the following best establishes a text-to-world connection with the passage?

Ans

✗ 1. Government agencies and financial institutions are increasingly adopting digital technologies to improve transparency, security, and service delivery.

✓ 2. Educational institutions and healthcare organisations are increasingly adopting virtual reality for training, therapy, and simulation.

✗ 3. Manufacturing industries and engineering firms are increasingly adopting automation to improve productivity, precision, and operational efficiency.

✗ 4. Media organisations and publishing companies are increasingly adopting digital platforms to expand accessibility, distribution, and audience engagement.

Comprehension:

Read the given passage carefully and choose the correct answers to the questions based on it.

Virtual reality (VR) games have transformed digital entertainment by creating immersive environments that allow players to interact with computer-generated worlds in real time. Unlike conventional video games played on flat screens, VR experiences employ head-mounted displays, motion sensors, and handheld controllers to simulate physical presence within a virtual environment. This heightened sense of immersion has expanded the application of VR beyond recreation, influencing education, healthcare, military training, and professional skill development. Consequently, virtual reality is increasingly viewed not merely as a gaming technology but as a versatile platform for experiential learning and simulation.

Despite its growing popularity, virtual reality gaming presents several challenges. Extended use may contribute to motion sickness, eye strain, or physical discomfort for some users. Moreover, concerns have emerged regarding excessive screen time, psychological dependence, and the potential effects of highly immersive environments on social interaction. Researchers therefore argue that responsible usage, combined with ergonomic design and informed user practices, is essential to maximise benefits while minimising potential risks.

The rapid evolution of virtual reality games reflects broader technological advances in artificial intelligence, graphics processing, and human-computer interaction. As hardware becomes more affordable and software increasingly sophisticated, VR is expected to become more accessible across diverse sectors. Nevertheless, its long-term success will depend on balancing technological innovation with ethical considerations, user safety, and meaningful applications. Ultimately, virtual reality games illustrate how emerging technologies can simultaneously entertain, educate, and reshape the ways in which individuals interact with digital environments.

SubQuestion No : 17

Q.17 Which of the following best expresses the central theme of the passage?

Ans

✗ 1. Virtual reality technologies are transforming digital entertainment by replacing conventional gaming platforms and experiences.

✓ 2. Virtual reality games offer significant opportunities beyond entertainment, but their responsible use remains essential.

✗ 3. Technological innovation should remain focused on recreational entertainment rather than educational or professional applications.

✗ 4. Emerging digital technologies are reducing direct human interaction while increasing dependence on automated virtual environments.

Generated by rank.qmaths.in

Comprehension:

Read the given passage carefully and choose the correct answers to the questions based on it.

Virtual reality (VR) games have transformed digital entertainment by creating immersive environments that allow players to interact with computer-generated worlds in real time. Unlike conventional video games played on flat screens, VR experiences employ head-mounted displays, motion sensors, and handheld controllers to simulate physical presence within a virtual environment. This heightened sense of immersion has expanded the application of VR beyond recreation, influencing education, healthcare, military training, and professional skill development. Consequently, virtual reality is increasingly viewed not merely as a gaming technology but as a versatile platform for experiential learning and simulation.

Despite its growing popularity, virtual reality gaming presents several challenges. Extended use may contribute to motion sickness, eye strain, or physical discomfort for some users. Moreover, concerns have emerged regarding excessive screen time, psychological dependence, and the potential effects of highly immersive environments on social interaction. Researchers therefore argue that responsible usage, combined with ergonomic design and informed user practices, is essential to maximise benefits while minimising potential risks.

The rapid evolution of virtual reality games reflects broader technological advances in artificial intelligence, graphics processing, and human-computer interaction. As hardware becomes more affordable and software increasingly sophisticated, VR is expected to become more accessible across diverse sectors. Nevertheless, its long-term success will depend on balancing technological innovation with ethical considerations, user safety, and meaningful applications. Ultimately, virtual reality games illustrate how emerging technologies can simultaneously entertain, educate, and reshape the ways in which individuals interact with digital environments.

SubQuestion No : 18

Q.18 According to the passage, which factor is identified as necessary for maximising the benefits of virtual reality gaming?

Ans

✔ 1. Responsible usage supported by ergonomic design

✘ 2. Continuous replacement of gaming hardware

✘ 3. Eliminating motion sensors from gaming systems

✘ 4. Restricting virtual reality to military applications

Comprehension:

Read the given passage carefully and choose the correct answers to the questions based on it.

Virtual reality (VR) games have transformed digital entertainment by creating immersive environments that allow players to interact with computer-generated worlds in real time. Unlike conventional video games played on flat screens, VR experiences employ head-mounted displays, motion sensors, and handheld controllers to simulate physical presence within a virtual environment. This heightened sense of immersion has expanded the application of VR beyond recreation, influencing education, healthcare, military training, and professional skill development. Consequently, virtual reality is increasingly viewed not merely as a gaming technology but as a versatile platform for experiential learning and simulation.

Despite its growing popularity, virtual reality gaming presents several challenges. Extended use may contribute to motion sickness, eye strain, or physical discomfort for some users. Moreover, concerns have emerged regarding excessive screen time, psychological dependence, and the potential effects of highly immersive environments on social interaction. Researchers therefore argue that responsible usage, combined with ergonomic design and informed user practices, is essential to maximise benefits while minimising potential risks.

The rapid evolution of virtual reality games reflects broader technological advances in artificial intelligence, graphics processing, and human-computer interaction. As hardware becomes more affordable and software increasingly sophisticated, VR is expected to become more accessible across diverse sectors. Nevertheless, its long-term success will depend on balancing technological innovation with ethical considerations, user safety, and meaningful applications. Ultimately, virtual reality games illustrate how emerging technologies can simultaneously entertain, educate, and reshape the ways in which individuals interact with digital environments.

SubQuestion No : 19

Q.19 Which inference can reasonably be drawn from the passage?

Ans

✔ 1. As virtual reality technology becomes more affordable, its adoption is likely to expand into additional professional fields.

✘ 2. As virtual reality technology becomes more widespread, traditional learning methods are likely to become completely obsolete.

✘ 3. As virtual reality technology becomes more accessible, ethical concerns are likely to disappear without further regulation.

✘ 4. As virtual reality technology becomes more advanced, health-related side effects are likely to affect every regular user.

Generated by rank.qmaths.in

Comprehension:

Read the given passage carefully and choose the correct answers to the questions based on it.

Virtual reality (VR) games have transformed digital entertainment by creating immersive environments that allow players to interact with computer-generated worlds in real time. Unlike conventional video games played on flat screens, VR experiences employ head-mounted displays, motion sensors, and handheld controllers to simulate physical presence within a virtual environment. This heightened sense of immersion has expanded the application of VR beyond recreation, influencing education, healthcare, military training, and professional skill development. Consequently, virtual reality is increasingly viewed not merely as a gaming technology but as a versatile platform for experiential learning and simulation.

Despite its growing popularity, virtual reality gaming presents several challenges. Extended use may contribute to motion sickness, eye strain, or physical discomfort for some users. Moreover, concerns have emerged regarding excessive screen time, psychological dependence, and the potential effects of highly immersive environments on social interaction. Researchers therefore argue that responsible usage, combined with ergonomic design and informed user practices, is essential to maximise benefits while minimising potential risks.

The rapid evolution of virtual reality games reflects broader technological advances in artificial intelligence, graphics processing, and human-computer interaction. As hardware becomes more affordable and software increasingly sophisticated, VR is expected to become more accessible across diverse sectors. Nevertheless, its long-term success will depend on balancing technological innovation with ethical considerations, user safety, and meaningful applications. Ultimately, virtual reality games illustrate how emerging technologies can simultaneously entertain, educate, and reshape the ways in which individuals interact with digital environments.

SubQuestion No : 20

Q.20 **Which of the following best summarizes the passage?**

Ans

✗ 1. Virtual reality technologies have influenced modern recreation through immersive gaming experiences, evolving consumer preferences, and expanding digital entertainment markets.

✓ 2. Virtual reality games have evolved into versatile technologies with applications beyond entertainment, although their long-term success depends on responsible use, accessibility, and ethical development.

✗ 3. Virtual reality technologies have transformed digital entertainment through immersive experiences, advanced hardware, and increasingly sophisticated interactive gaming environments.

✗ 4. Virtual reality technologies have raised important questions about digital innovation, user engagement, and technological change across contemporary society.

"

Generated by rank.qmaths.in